Completa con los números que faltan.

	2								
				15					**20**
								29	
		33							

Calcula

+	20	10	15
5			
10			
15			

-	20	10	15
10			
5			
8			

Resuelve estas pirámides.





26 Calcula -2 O -2 O -2 O -2 O -2 O -2 O -2 O -2 O