BMA BILINGUAL SCHOOL PROJECT
Standardize test 2021

Subject: Mathematics **Grade 2**

Instruction: Choose the correct answer.
Cross (×) number 1, 2 or 3 on your answer sheet.

1.How do we write seven hundred and fifty-nine in numbers? (M1.1 G2/1)
1. 957
2. 759
3. 597

2. Which of the following is arranged from the greatest to least? (M1.1 G2/2)
1. 345, 467, 521
2. 124, 223, 243
3. 967, 878, 790

3. Which equation is correct? (M1.1G2/.3)
1. 300+80+7 > 200+80+6
2. 500+70+4 = 500+30+4
3. 700+50+4 < 700+40+5

4. Which has the total of 678? (M1.1 G2/4)
1. 512 + 116
2. 398 + 280
3. 298 + 330

5. I bought 4 containers of juice. Each container had a volume of 7 liters. How much juice did I buy? (M2.1 G2/5)

1. 32 liters of juice
2. 24 liters of juice
3. 28 liters of juice

6. San is 23 kilograms heavier than Pom. If Pom weighs 20 kgs. How much does San's weigh? (M1.1 G2/4)
1. 3 kilograms
2. 43 kilograms
3. 63 kilograms

7. There are 489 people in our office. 298 are men. How many are women? (M1.1 G2/7)
1. 191 women
2. 181 women
3. 787 women

8. A box of sushi costs 300 baht. Petty buys 3 boxes and she gives 1,000 baht to a shopkeeper. How much change does she get? (M1.1 G2/8)
1. 300 baht
2. 200 baht
3. 100 baht

9. Complete the number pattern.
215, 230, 245 ____, _____, _____.(M1.1 G2/1)
1. 265 , 285 , 305
2. 250 , 265 , 270
3. 260 , 275 , 290

10. Sodsai takes a bus to school. The bus journey takes 35 minutes. If she gets on the bus at 7:20. What time will she reach her school? (M2.1 G2/1)
1. 7: 55 am
2. 8: 00 am
3. 8:05 am

LIVEWORKSHEETS

11. The height of the mother is 165 cm, the height of the son is 128 cm. Find the difference on their height. (M2.1 G2/2)

1. 33 cm
2. 35 cm
3. 37 cm

12. Which is the heaviest? (M2.1 G2/4)

1. fish
2. pumpkin
3. watermelon

13.If the volume of each bottle is 30 ml. How many bottles are needed to fill a container with a capacity of 900 ml. (M2.1G2/5)

900 ml. 30 ml.

1. 30 bottles
2. 40 bottles
3. 50 bottles

14. Which container has the <u>least</u> capacity? (M2.1 G2/6)

1. A cup of coffee
2. A jar of apple juice
3. A bottle of water

15. Which is a cylinder ? (M2.2 G2/1)

1. 2. 3. 

16. How do we write four hundred and forty-nine in numbers? (M1.1 G 2/1)

1. 494
2. 449
3. 949

17. Which of the following is arranged from the least to greatest? (M1.1 G2/2)

1. 420, 560, 670, 890, 900
2. 210, 460, 609, 810, 560
3. 709, 609, 508, 405, 309

18. Which is NOT correct? (M1.1 G2/.3)

1. 100 +50+9 < 300+10+2
2. 500+20+5 = 500+20+5
3. 400+10+2 > 400+20+2

19. The sum of 456 and 167 is? (M1.1 G2/.4)

1. 623
2. 624
3. 632

20. Max bought 6 boxes of cake. Each box has 17 pieces. How many pieces of cakes did he buy? (M1.1 G2/.5)

1.102 pieces
2.104 pieces
3.106 pieces

21. There are 240 pupils in the school. The director divided them into 8 groups. How many pupils in each group? (M1.1 G2/.6)

LIVEWORKSHEETS

1. 50 pupils
2. 40 pupils
3. 30 pupils

22. Sara had 380 pens in her shop. At the end of the day, She had 185 pens left. How many pens did she sell on that day? (M1.1 G2/7)
    1. 185 pens
    2. 195 pens
    3. 175 pens

23. Teacher Sally puts the pupils in 8 rows. Each row has 15 pupils. How many pupils are there altogether? (M1.1 G2/.5)
    1. 140 pupils
    2. 130 pupils
    3. 120 pupils

24. Which product has the lowest sale? (M3.1 G2/1)
    1. pen
    2. ruler
    3. eraser

Product	apr	may	jun
Pen	10	60	54
Ruler	20	44	3
Pencil	30	4	55
Eraser			64

25. What time is shown on the picture? (M2.1 G2/1)
    1. 10:18
    2. 10:28
    3. 10:38

26. Nicole had 577 cm. of cloth. She used 239 cm of it in making shirt. What is the length of the cloth left? (M.2.1 G2/2)
    1. 338 cm.
    2. 318 cm.
    3. 238 cm.

27. How much does the banana weigh? (M.2.1 G2/4)

    1. The banana weighs 2 kg and 500 grams.
    2. The banana weighs 3 kilograms.
    3. The banana weighs 2 kg and 800 grams.

28. What is the capacity of the 3 cylinders? (M2.1 G2/6)

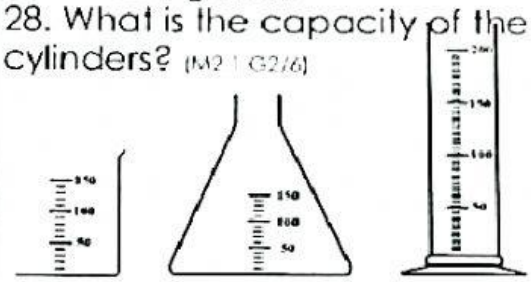

    1. 500 ml
    2. 300 ml
    3. 200 ml

29. What is the sum of 423 and 279? (M1.1 G2/4)
    1. 702
    2. 802
    3. 902

30. How much longer is the pen than the crayon? (M2.1 G2/3)
    1. 6 cm.
    2. 4 cm.
    3. 2 cm.



****

LIVEWORKSHEETS