NOMBRE:

MODELO GRUPAL Y LINEAL DE LA MULTIPLICACIÓN

1. **Selecciona la multiplicación que representa a la ilustración:**

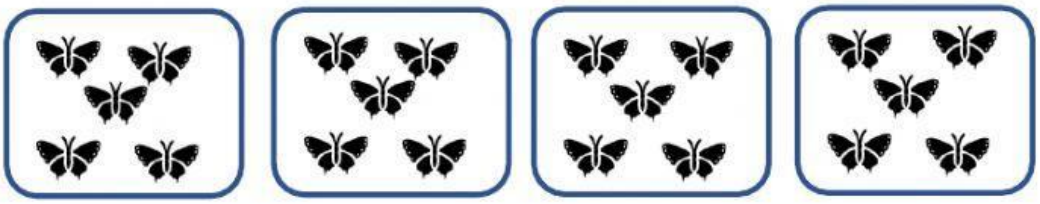

4 x 4 = 16

4 x 5 = 20

5 x 5 = 25



6 x 2 = 12

3 x 5 = 15

3 x 6 = 18

6 x 6 = 36

5 x 5 = 25

5 x 8 = 40

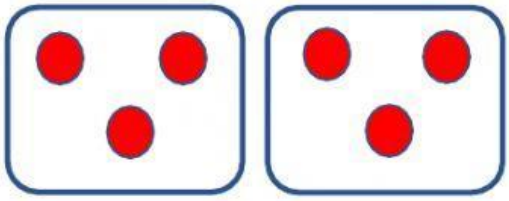

3 x 3 = 6

3 x 3 = 9

3 x 2 = 6

LIVEWORKSHEETS

2. **Une con una línea según corresponda cada ilustración a su multiplicación:**



4 x 5 = 20

3 x 5 = 15

3 x 6 = 18

5 x 4 = 20

5 x 7 = 35



6 x 7 = 42

LIVEWORKSHEETS

MODELO LINEAL

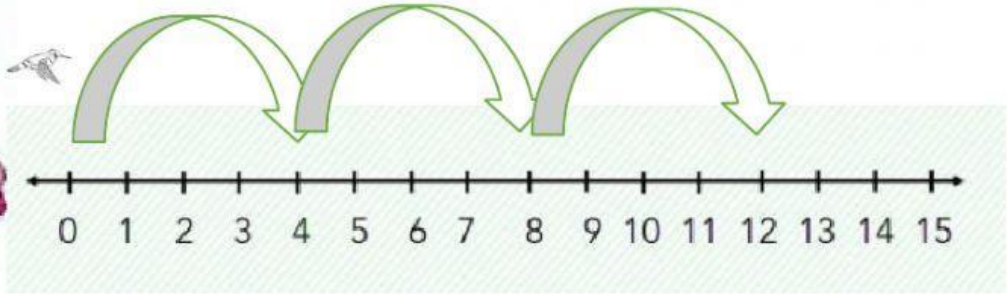

☐ ✖ ☐ = ☐

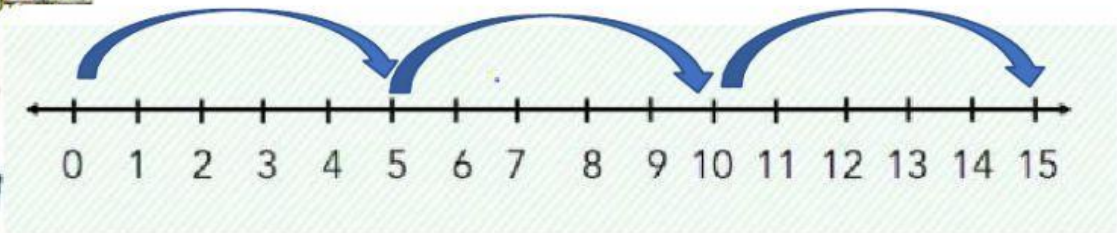

☐ ✖ ☐ = ☐

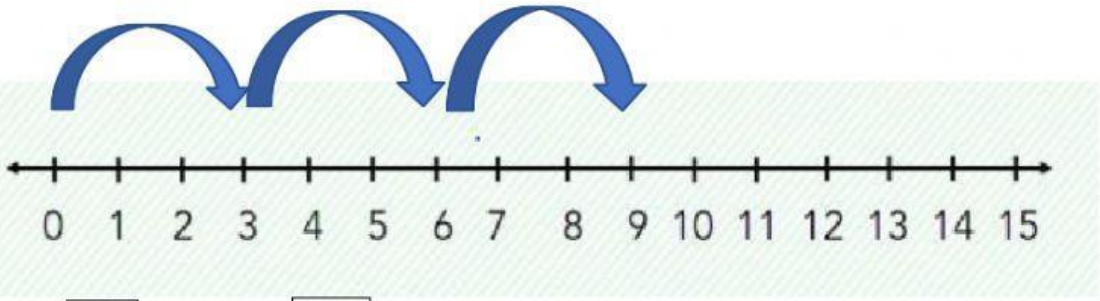

☐ ✖ ☐ = ☐

LIVEWORKSHEETS