Friday 4th March, 2022.

Mathematics Test

Polygons

Name these polygons according to their number of sides.

1. four sides

2. three sides

3. eight sides

4.  five sides

5.  seven sides

6. 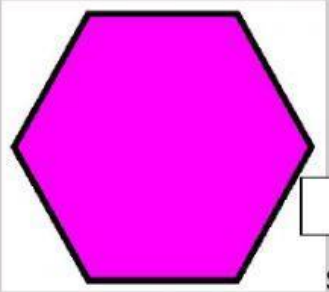 six sides

LIVEWORKSHEETS

Time

7. It was time for school. When I looked at the clock, the minute hand was on 6 and the hour hand was on 8. What time was it?

Ans:

8. Mary had a dentist appointment. When she looked at the clock, the minute hand was on 12 and the hour hand was on 2. What time was it?

Ans:

9. It was time to go to the cinema. When Tim looked at the clock, this is what is showed. What time is it?

Ans:

10. The analog clock below shows the time Tracy returned from the market.

What time did Tracy return from the market?

Ans:

LIVEWORKSHEETS