Triangles

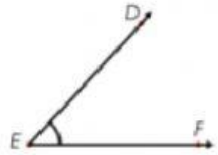

An **acute angle** is less than 90°

A **right angle** is exactly 90°

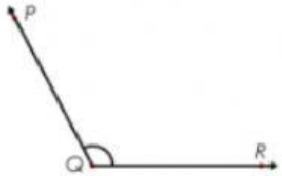

An **obtuse angle** is greater than 90°

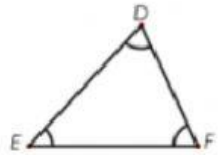

An **acute triangle** has 3 acute angles.

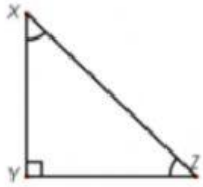

A **right triangle** has 1 right angle and 2 acute angles.

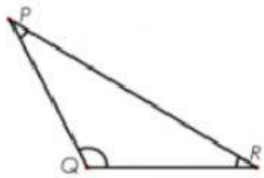

An **obtuse triangle** has 1 obtuse angle and 2 acute angles.

Identify each type of triangle as **acute**, **right** or **obtuse**.

a.

_____

b.



_____

c.

_____

d.

_____

e.

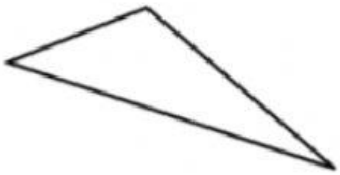

_____

f.

_____

LIVEWORKSHEETS