REPÀS 2

REGINA CARMELI HORTA

1. Situa el nom de cada figura en el lloc corresponent.

quadrilàter regular, hexàgon, decàgon, rombe, pentàgon, trapezi, trapezoide, octàgon.

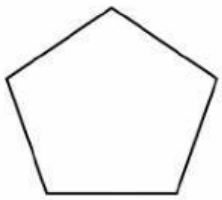

.....

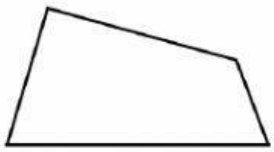

.....



.....

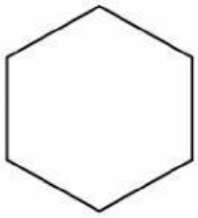

.....

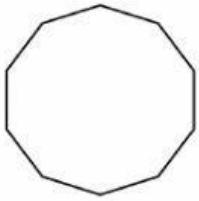

.....

.....

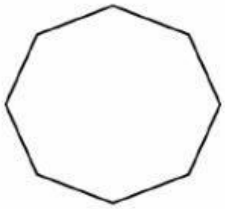

.....

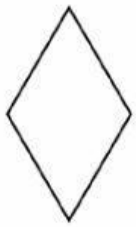

.....

2. Escriu el nombre de diagonals que tenen les següents figures:

(Recorda que les diagonals són segments que van d'un vèrtex a un altre vèrtex que no siguin consecutius).

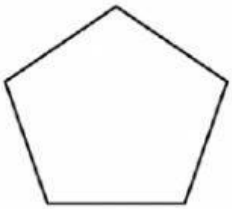

Té ..... diagonals.

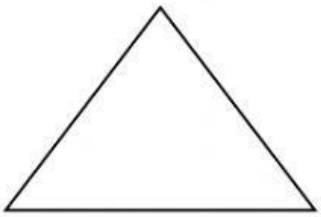

Té ..... diagonals.



Té ..... diagonals.

LIVEWORKSHEETS

3. Calcula el perímetre i l'àrea de les següents figures i escriu el resultat a l'espai corresponent.

(Recorda que el perímetre és el total de tots els costats i l'àrea és el càlcul de l'espai interior que ocupa la figura).

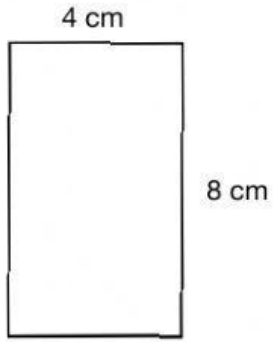

Perímetre: .....cm

Àrea: .....cm^2

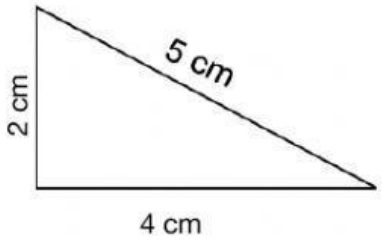

Perímetre: .....cm

Àrea: .....cm^2

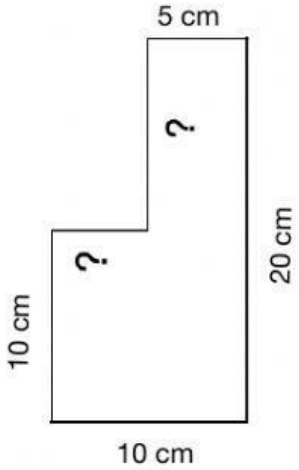

Perímetre: .....cm

Àrea: .....cm^2

LIVEWORKSHEETS