IQ School
Primary 3 ES

Maths
Review for month of February 2022

Name: ( )	Class:	Date:
Parent's Initial:	Mark: /55	Result: %

Section A: Multiple Choice Questions (10pts)

1. The most popular visitors who visited the library on a Monday afternoon was_____.

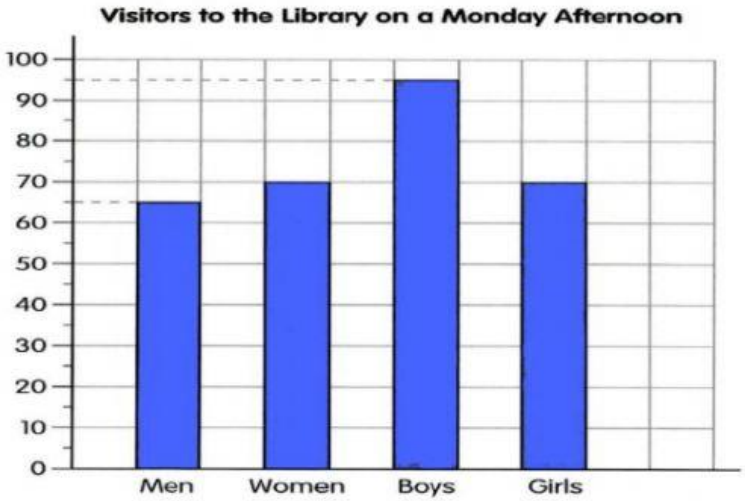

a. Men b. Boy
c. Girls d. Women ( )

2. The total storybooks of Bala and David is _____.

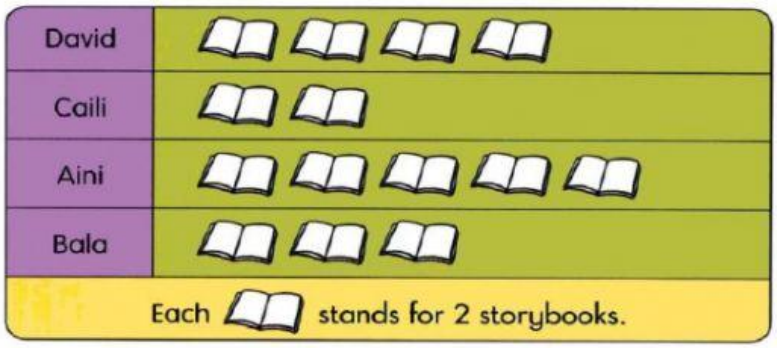

a. 7 b. 8
c. 14 d. 16 ( )

LIVEWORKSHEETS

3. Which fruit is twice as many as the apple?

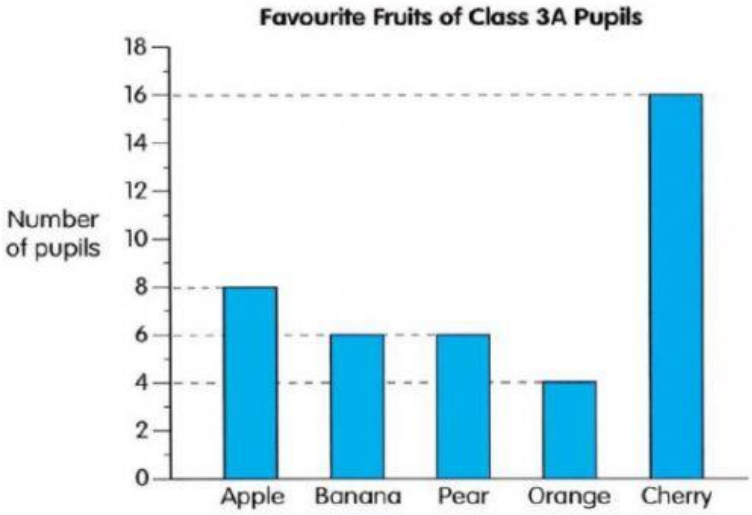

a. Orange b. Pear
c. Banana d. Apple ( )

4. What is the numerator of the fraction below?

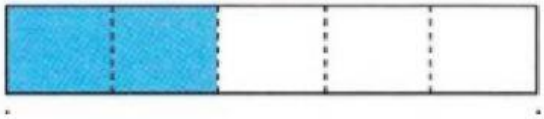

a. 2 b. 3
c. 6 d. 5 ( )

5. What is the denominator of the fraction below?

a. 6 b. 9
c. 10 d. 3 ( )

LIVEWORKSHEETS

6. What fraction of the figure is shaded?

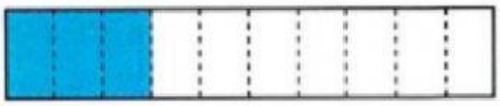

a. $\frac{3}{7}$ b. $\frac{7}{3}$

c. $\frac{3}{10}$ d. $\frac{7}{10}$ ( )

7. Which fraction is the greatest?

a. $\frac{3}{12}$ b. $\frac{7}{12}$

c. $\frac{9}{12}$ d. $\frac{5}{12}$ ( )

8. Which fraction is the smallest?

a. $\frac{1}{3}$ b. $\frac{1}{4}$

c. $\frac{1}{7}$ d. $\frac{1}{9}$ ( )

9. Which following figure represents $\frac{2}{3}$?

a. 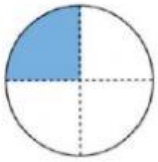

b. 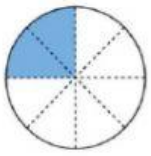

c.

d. 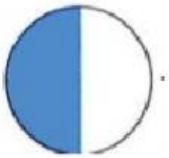

( )

LIVEWORKSHEETS

10. Arrange each set of fractions in order. Begin with the smallest.

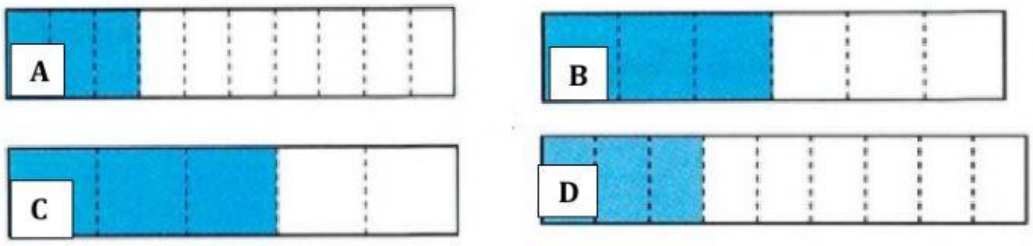

a. A, B, C, D b. A, D, B, C
c. A, D, B, C d. A, C, D, B ( )

Section B. Short Answer Questions (20 pts)

Work out the following carefully.

11. $\frac{3}{8}$ and _____ make 1 whole.

Answer: _____

12. What fraction is shaded?

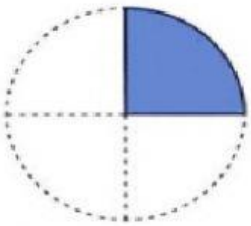

Answer: _____

13. Write this fraction in words: $\frac{3}{7}$

Answer: _____

LIVEWORKSHEETS

IQ School
Primary 3 ES

Maths
Review for month of February 2022

14 The sum of $\frac{2}{9} + \frac{3}{9}$ is_____.

Answer: _____

15 The difference between $\frac{5}{12}$ and $\frac{7}{12}$ is_____.

Answer: _____

16. Two fractions have the same numerator. The fraction with smaller denominator will be _____.

Answer: _____

17. _____is the fraction with numerator and denominator evenly.

Answer: _____

18. How many more triangles must be shaded so that $\frac{5}{8}$ of the figure will be shaded?

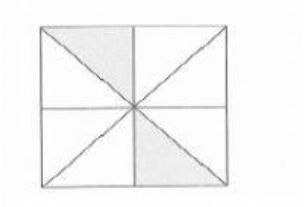

Answer: _____

19. $\frac{6}{10}$ is _____ than $\frac{1}{10}$.

Answer: _____

20. $\frac{4}{9}$ is _____ than $\frac{4}{7}$.

Answer: _____

LIVEWORKSHEETS

IQ School Maths
Primary 3 ES Review for month of February 2022

Section C. Solving Word Problems. (25pts)

21. Bernie cut a strawberry into 10 equal slices. Her children ate 4 slices.
What fraction was left over?

Answer: _____.

22. Jasmine spent $\frac{3}{11}$ of her money on a dress and $\frac{7}{11}$ of her money on her handbag.
What fraction of her money did she spend altogether?

Answer: _____.

23. Rosy bought an ice- cream cake. Her family ate $\frac{2}{7}$ and her friend ate $\frac{3}{7}$ of it.
a. What fraction of the cake was eaten?



Answer: _____.

LIVEWORKSHEETS

b. What fraction of the cake was left over?

Answer: _____.

24. The bar graph shows the siblings of the Primary 3 pupils in a school.

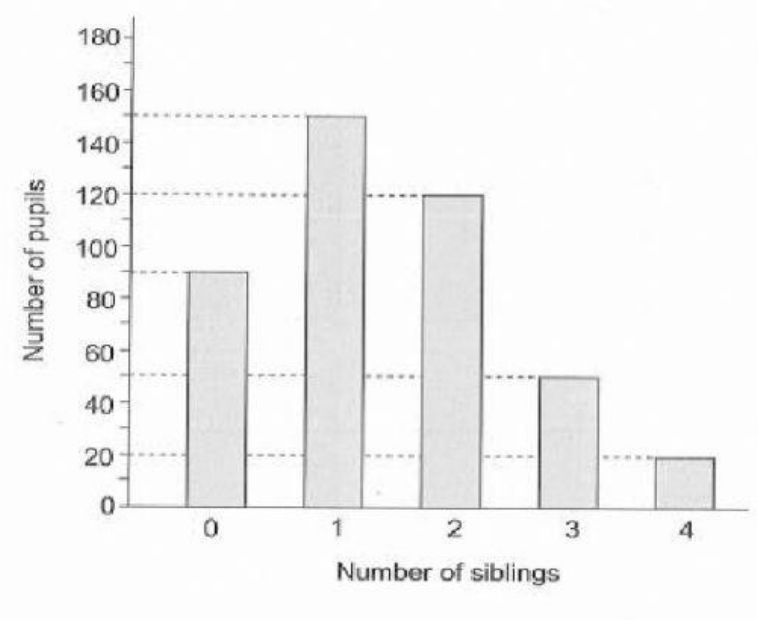

a. How many Primary 3 pupils are there altogether in the school?

Answer: _____.

b. What is the total number of siblings all the students have?

Answer: _____.

LIVEWORKSHEETS

25. The bar graphs show the numbers of the pupils from class 5A who had lunch at the canteen in a certain week.

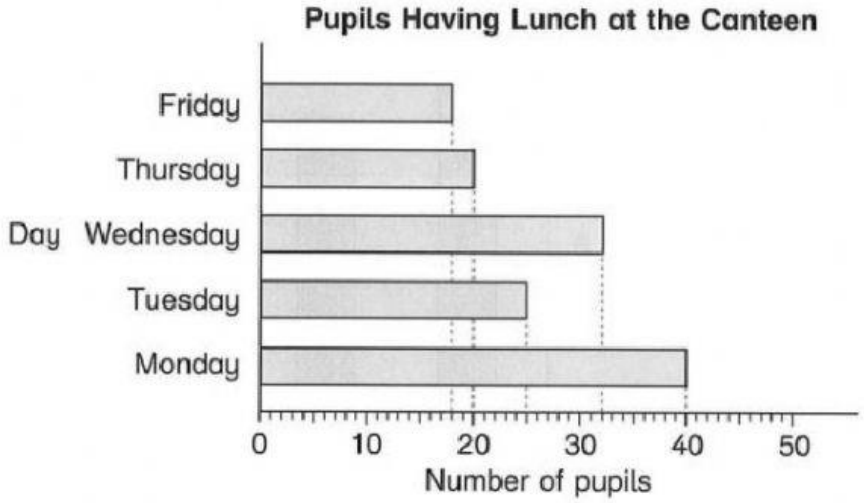

a. What is the title of the bar graph?

Answer:_____.

b. How many pupils had lunch at the canteen on Friday?

Answer:_____.

c. Which day had twice as many students who had lunch at canteen as on Thursday?

Answer:_____.

d. How many fewer pupils had lunch at the canteen on Tuesday to Wednesday?

Answer:_____.

e. What was the total number of students who had lunch at the canteen in a certain week?

Answer:_____.

*** End of paper ***

LIVEWORKSHEETS

IQ School
Primary 3 ES

Maths
Review for month of February 2022

LIVEWORKSHEETS