AREA AND PERIMETER

Calculate the area and perimeter for each figure.

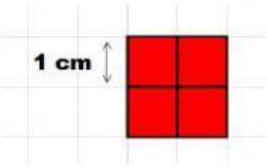

Area: ……. centimeters square
Perimeter: ……cm

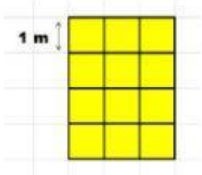

Area: ……. meters square
Perimeter: ……. m

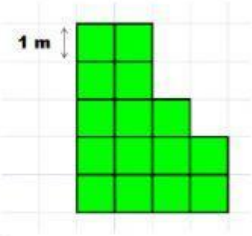

Area: ……. meters square
Perimeter: ……. m

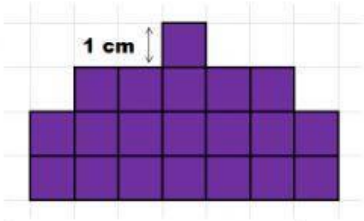

Area: ……. centimeters square
Perimeter: ……cm

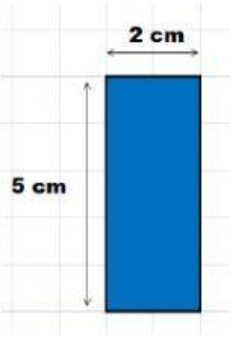

Area: ……. centimeters square
Perimeter: ……cm

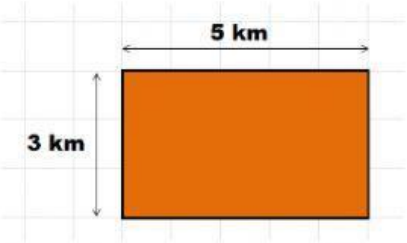

Area: ……. kilometers square
Perimeter: ……. Km

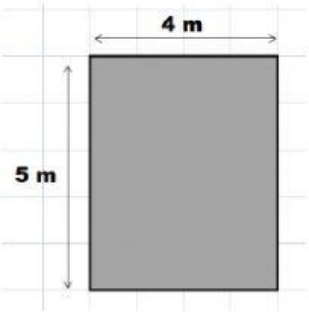

Area: ……. meters square
Perimeter: ……. m

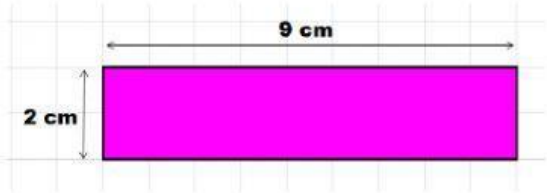

Area: ……. centimeters square
Perimeter: ……cm