DL.D.A.V Model School

Science Objective Exam
Final Term Examination

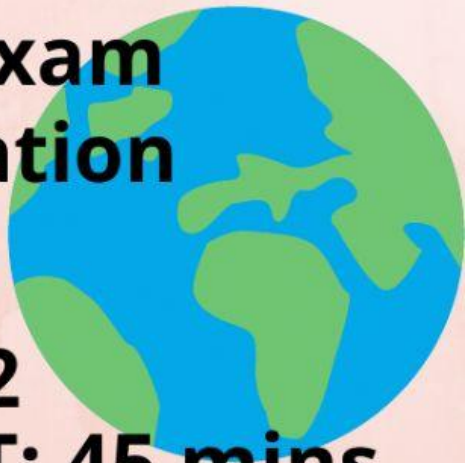

Class: IIII

Session: 2021-22

M.M: 20 **T.T: 45 mins**

Q1. Choose the correct option and write a/b/c/d in the blank given :

i) Shrubs can grow more than _____ meters

a) 6 meters b) 5 meters c) 4 meters d) 10 meters

ii) _____ can eat animals which are bigger than them in size.

a) Dogs b) Snakes c) Jackals d) crows

iii) Age at which babies start eating semi-solid food:

a) 1-month b) 1-year c) 9 months d)6 months

iv) _____ is the largest river in the world.

a) Yamuna b) Thames c) Nile d) Ganges

v) _____ provides food and shelter to many animals.

a) Water b) Land c) Sea d) Forest

LIVEWORKSHEETS

Q2. Fill in the blanks with appropriate answers:

1. Animals living in desert can tolerate _____
2. _____ live only for one or two seasons and produce flowers, seeds in this period only.
3. Animals depend on _____ and other animals for their food.
4. An elephant uses its _____ to pluck leaves or suck water.
5. _____ is the powder made by crushing grains.

LIVEWORKSHEETS

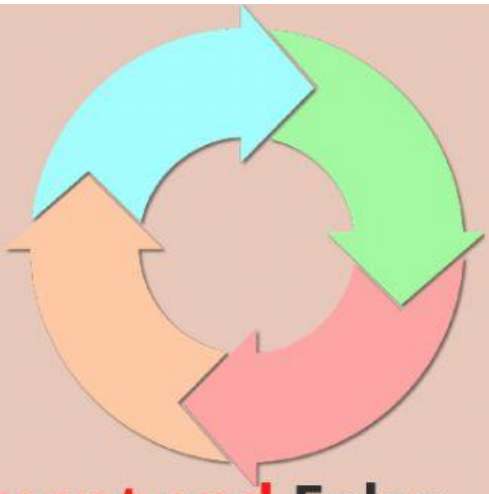

Q3. Write True for correct statement and False for incorrect statement:

1. **India is surrounded by the Pacific ocean on the southern side. _____**
2. **A glass of milk can substitute your one meal. _____**
3. **Turtles can only survive in water. _____**
4. **Grass is an example of a climber. _____**
5. **Rabbit , squirrel and rat are example of gnawing animals._____**



LIVEWORKSHEETS

Q4. Match the following and write the numbers in the box :

1.Elephant	Pea plant
2. Coriander	Desert
3. Climber	Sugarcane
4. Snake	Energy giver
5. Almond	Bhakra Nangal
6. Dam	Small Leaf

THE END

LIVEWORKSHEETS