المدرسة الانجليزية الدولية الخاصة - ابوظبي

Private International English School - AbuDhabi

Bharatiya Vidya Bhavan Middle East

Grade 3

Activity worksheet (level -1)

Solid Shapes

1.Match the shapes that are the same:

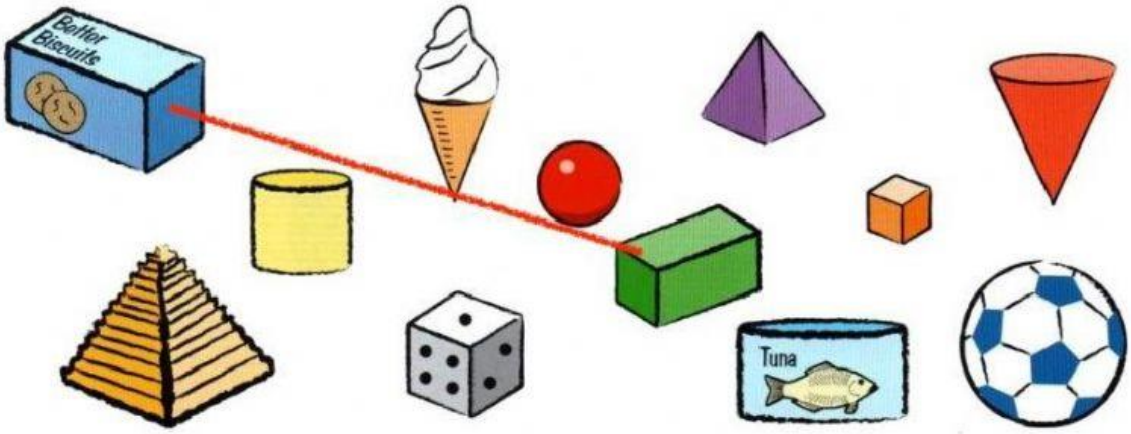

2.Count the shapes:



a) ☐ b) ☐ c) ☐

d) ☐ e) ☐

LIVEWORKSHEETS

Activity worksheet (level -2)

Properties of 3D Shapes

	Sphere	Cube	Cone	Cylinder
Faces				
Edges				
Vertices				

Drag and drop the shape next to its description

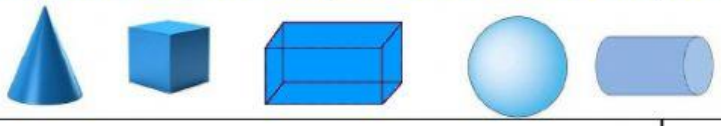

This shape has 2 faces	
This shape has 3 faces	
This shape has 6 equal faces	
This shape has 12 edges	
This shape has 0 vertices and 0 edges	

LIVEWORKSHEETS

Activity worksheet (level -3)

Click on the name of each shape and fill in the blanks

cone cube sphere

faces:_____

edges:_____

vertices: _____

cylinder cone cube



faces:_____

edges:_____

vertices: _____

rectangular prism sphere cube

faces:_____

edges:_____

vertices: _____

cube sphere cylinder

faces:_____

edges:_____

vertices: _____

pyramid cylinder cube

faces:_____

edges:_____

vertices: _____

cone rectangular pyramid prism

faces:_____

edges:_____

vertices: _____

LIVEWORKSHEETS

LIVEWORKSHEETS