Name: ..... Date: .....

Year: .....

## EXERCISE 1.7: MEASURING LENGTH (PART 1)

1. Find the length of each bar. Write your answer in centimeter (cm).

a)

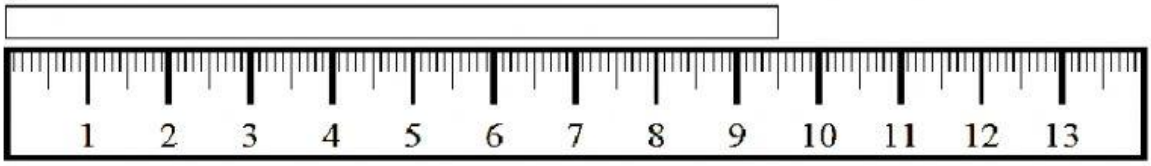


Answer: .....

b)

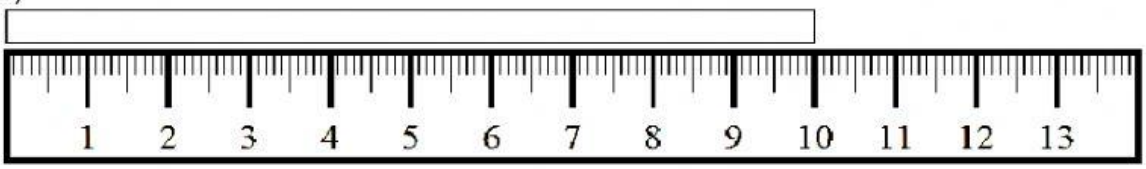


Answer: .....

c)

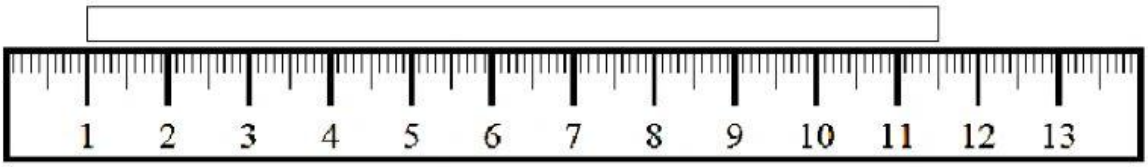


Answer: .....

d)

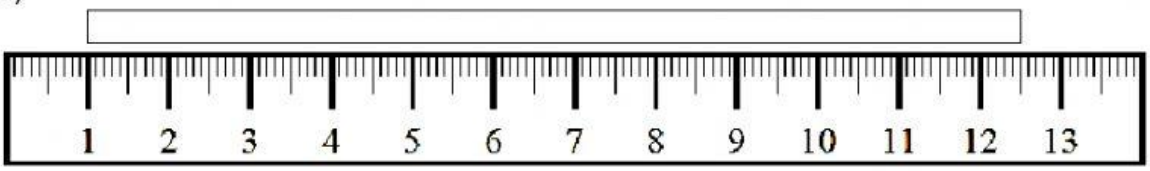


Answer: .....

LIVEWORKSHEETS

e)

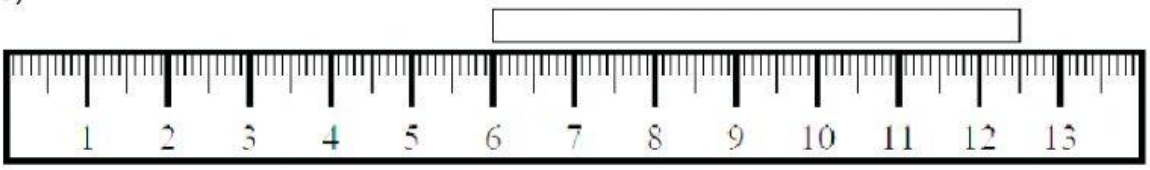


Answer: ……

f)

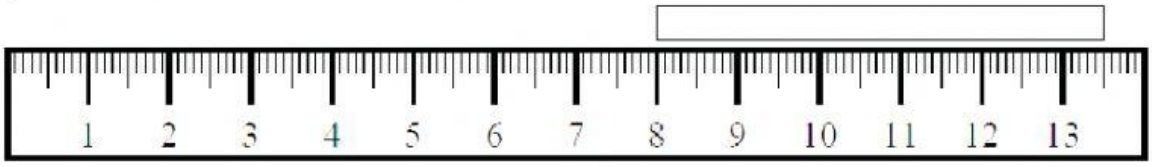


Answer: ……

2. Read and write the measurements shown below

a)

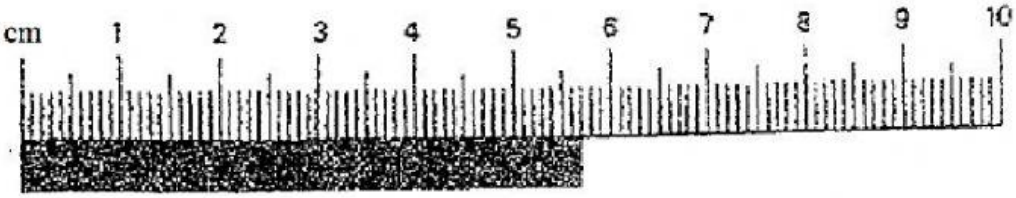


Length of black line: ……

b)




Length of paper clip: ……

LIVEWORKSHEETS

3. Define / what is length?

……

4. State the S.I unit for length. ……..

5. Name the instrument which you use to measure each of the following.

a) Length of a football field : ……..

b) Length of a book : ……..

c) Depth of a test tube : ……..

d) Thickness of a hair : ……..

e) Internal diameter of a beaker : ……..

6. Identify the following instruments.

| | | |
|---|---|---|
| | 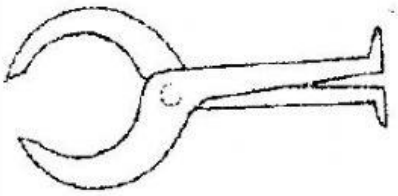 | 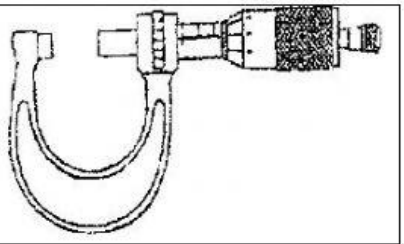 |
| …… | …… | …… |

.

LIVEWORKSHEETS