Name: _____ Nos: ___ Grade: ___ LESSON QUIZ 3

Circle Theorem – G9Guidance: 1. Read each question carefully before you begin answering it. 2. Check your answers seem right from the table given and then drag it appropriately.

Question 1: Calculate the size of x in the circles below. The lines AB and AC are tangents.

(a)

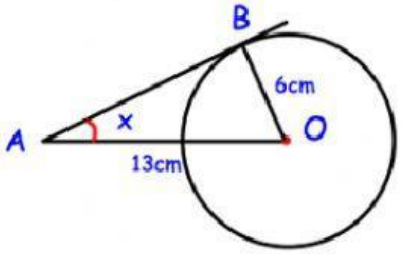

(b)

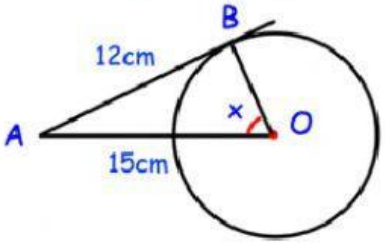

(c)

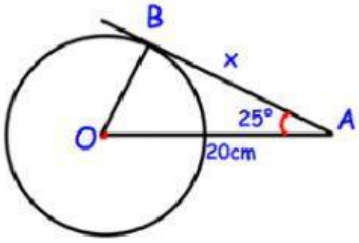

(d)

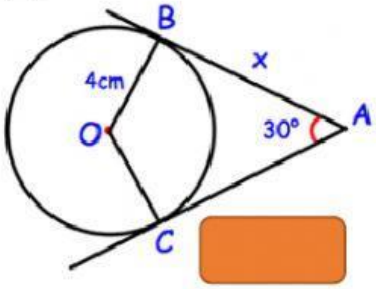

(e)

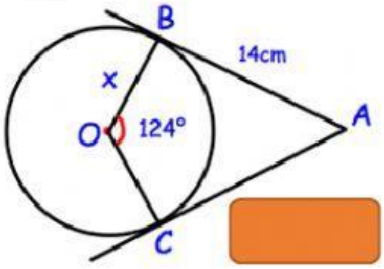

(f)

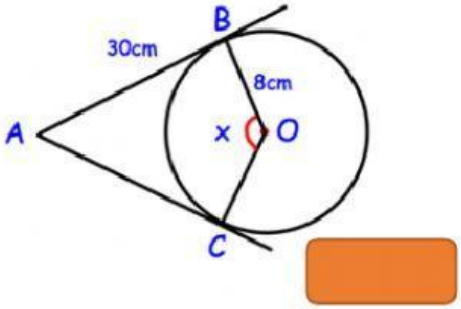

Question 2: Find the missing angles labelled in each of these circles

(a)

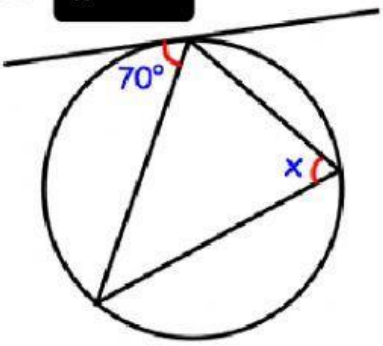

(b)

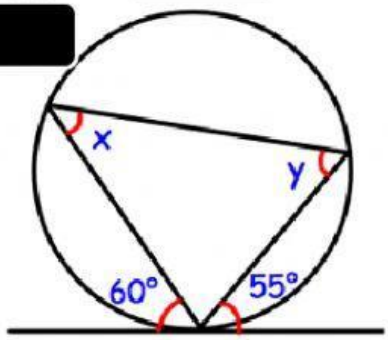

(c)

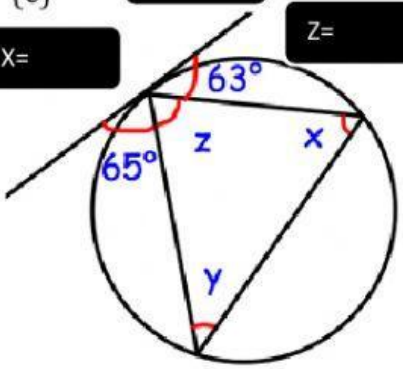

52^0	14.93 cm	27.47^0	150.1^0	18.12cm	70^0
63^0	53.13^0	7.44cm	65^0	60^0	55^0

Click on 'finished' below then 'check my answers' well then take photos of both your score and workings. Upload via class point or Line ID – gpower11. Thanks!!!

IG: amb_ojo_oluwole_godspower

LIVEWORKSHEETS