Darbu veic:.....

Paralelograma pazīmes

Vai dotie četrstūri ir paralelogrami? Savu atbildi pamato:

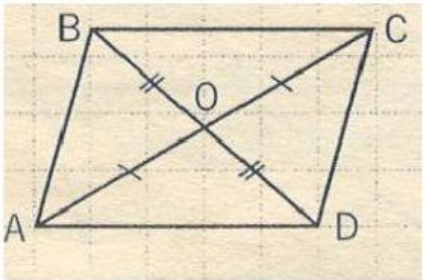

Dotais četrstūris ABCD ..... paralelograms, jo

.....

.....

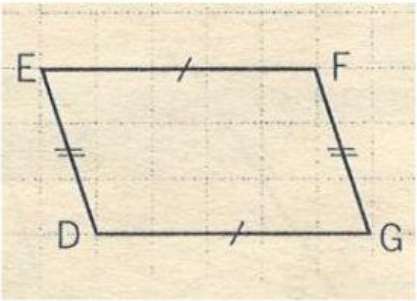

Dotais četrstūris ABCD ..... paralelograms, jo

.....

.....

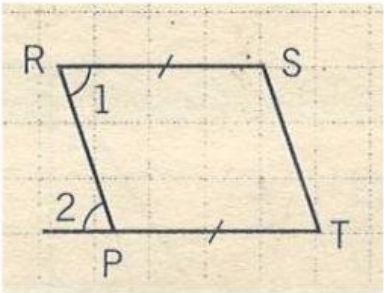

Dotais četrstūris ABCD ..... paralelograms, jo

.....

.....

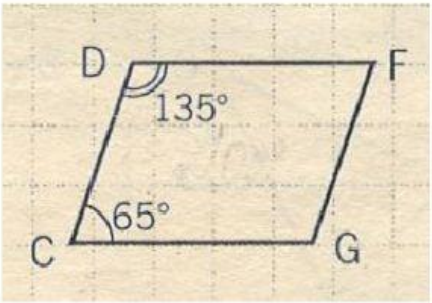

Dotais četrstūris ABCD ..... paralelograms, jo

.....

.....

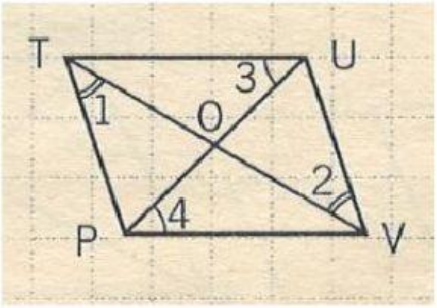

Dotais četrstūris ABCD ..... paralelograms, jo

.....

.....

LIVEWORKSHEETS