Тақырыпқа сай тапсырма орындап көрейік!

1. Сан аралығын координаталық түзуде кескіндеңдер:

$$(-6; +\infty)$$

a) 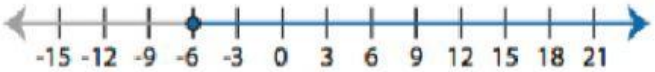

b)

c) 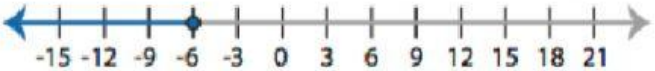

d)

$$(-\infty; 24]$$

a) 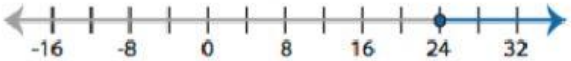

b) 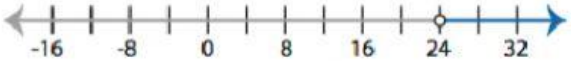

c) 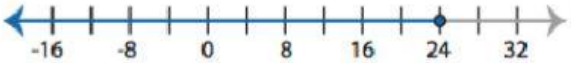

d) 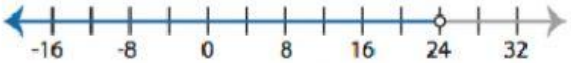

2. Теңсіздіктің шешімін координаталық түзуде кескіндеңіз:

$$2x > -12$$

a)

b) 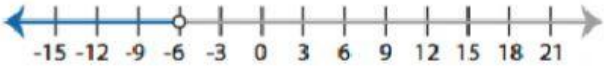

c) 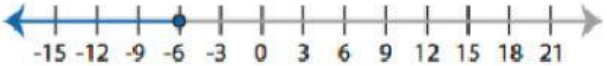

d)

$$x \leq 2x-6$$

LIVEWORKSHEETS

a) 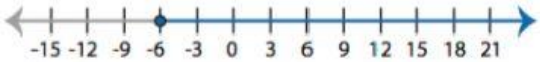

b) 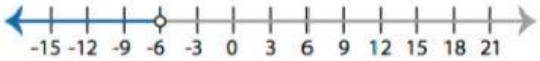

c) 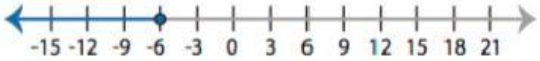

d) 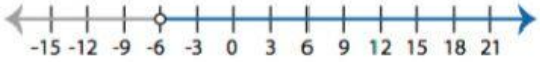

$4(x + 9) + 5x \geq 3x$

a) 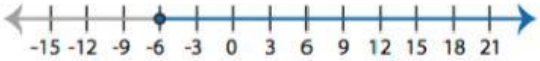

b) 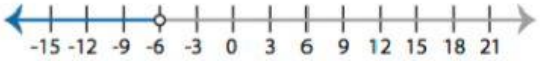

c) 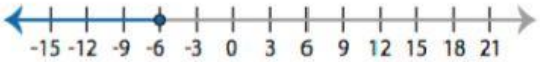

d) 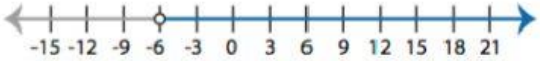

LIVEWORKSHEETS