ITINERARI 14: Classes de triangles i perímetres.

Escriu quin tipus de triangle és segons la classificació dels costats i el seu perímetre?

(TIPUS: Escriu **EQ** si és Equilàter, **IS** si és Isoscèles i **ES** si és Escalè).
(Escriu el nombre del perímetre seguit "cm"sense espais. **Exemple: 23cm**).

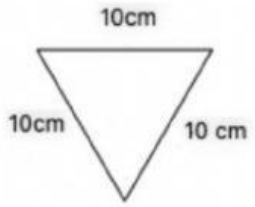

TIPUS:

Perímetre:

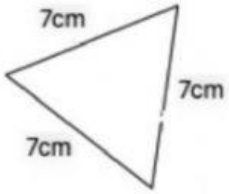

TIPUS:

Perímetre:

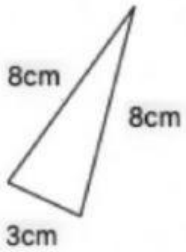

TIPUS:

Perímetre:

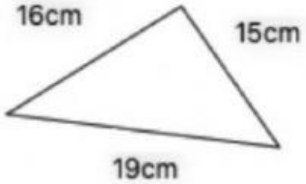

TIPUS:

Perímetre:

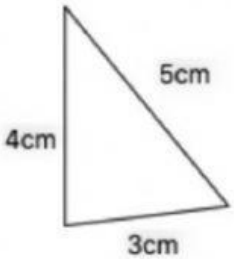

TIPUS:

Perímetre:

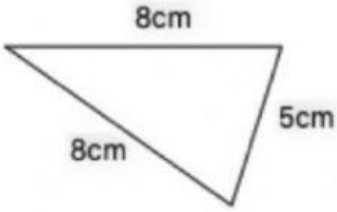

TIPUS:

Perímetre:

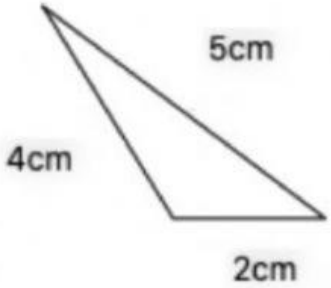

TIPUS:

Perímetre:

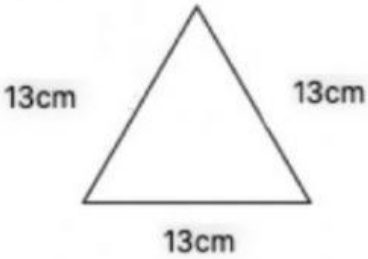

TIPUS:

Perímetre:

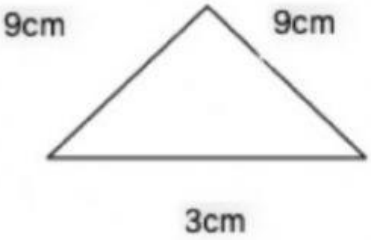

TIPUS:

Perímetre:

LIVEWORKSHEETS