Тақырыпқа сай тапсырма орындап көрейік!

1. Сан аралығын координаталық түзуде кескіндеңдер:

$$(-6; +\infty)$$

a)
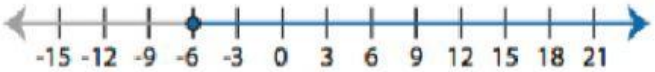

b)

c)
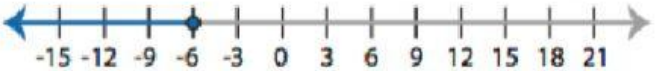

d)

$$(-\infty; 24]$$

a)
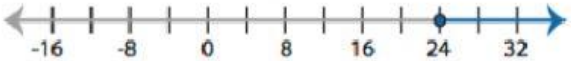

b)
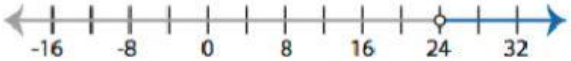

c)
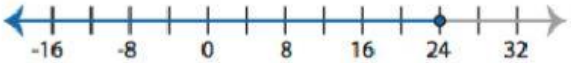

d)
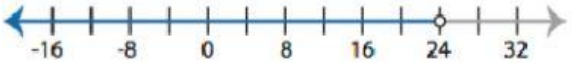

2. Теңсіздіктің шешімін координаталық түзуде кескіндеңіз:

$$2x \geq 36$$

a)

b)
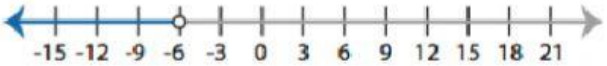

c)
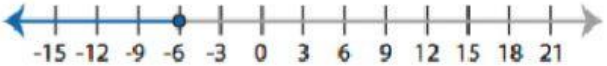

d)

$$x \leq 2x-6$$

LIVEWORKSHEETS

a) 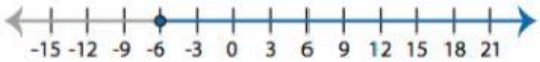

b) 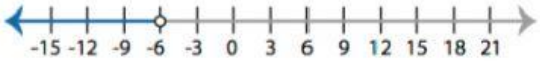

c) 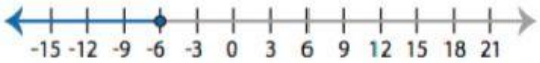

d) 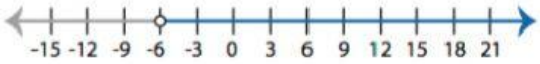

$4(x - 9) + 5x \geq 3x$

a) 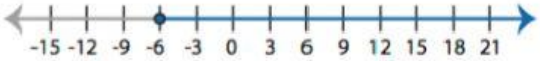

b) 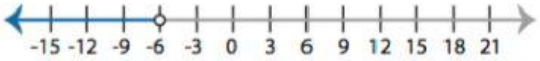

c) 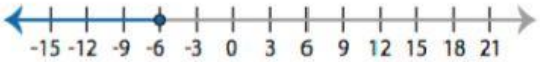

d) 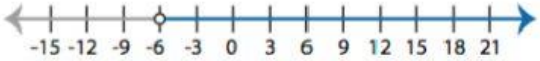

LIVEWORKSHEETS