Name(s)_____ Period _____ Date _____

Move It Move It

Debugging

Each of these algorithms has a mistake. Can you find the mistake and cross it out?

1)

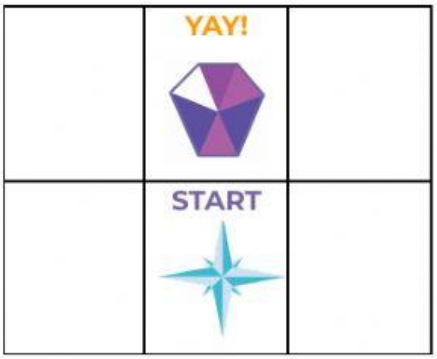

Move North

Move North

2)

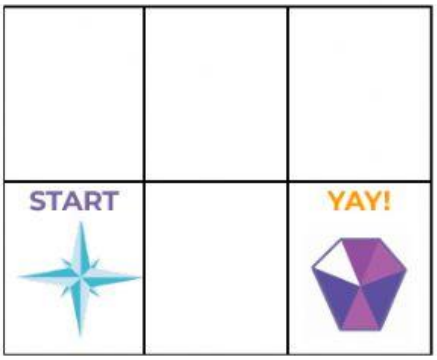

Move East

Move North

Move East

3)

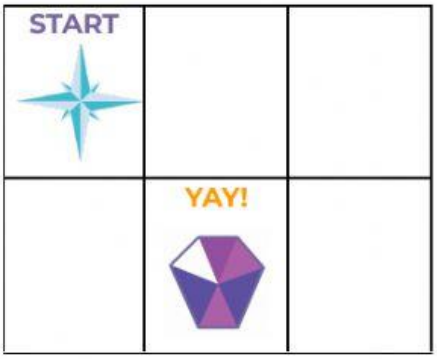

Move South

Move East

Move South

LIVEWORKSHEETS