Найди площадь фигуры

1)

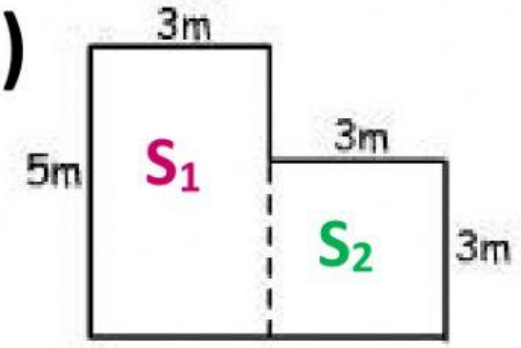

$S_{1=}$ m^2

$S_{2=}$ m^2

$S_{3=}$ m^2

2)

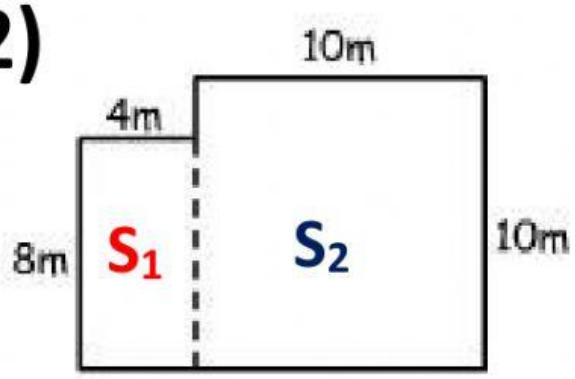

$S_{1=}$ m^2

$S_{2=}$ m^2

$S_{3=}$ m^2

3)

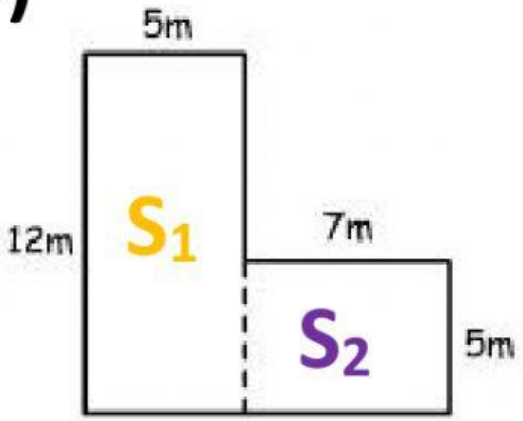

$S_{1=}$ m^2

$S_{2=}$ m^2

$S_{3=}$ m^2

LARISA ŽAVORONOKA
RĪGAS 89.VSK.

LIVEWORKSHEETS