TIPE SOAL PILIHAN GANDA

1) **Manakah gambar berikut yang merupakan segi empat, klik pada gambar yang tepat...**



TIPE SOAL SINGKAT

2) **Segitiga yang salah satu sudutnya 90^0 disebut dengan segitiga....**

TIPE SOAL URAIAN PANJANG

3) **Peregi Panjang adalah...**

TIPE SOAL DROP DOWN

4) **Gambar bangun ruang di bawah ini adalah...**

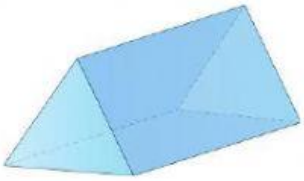

LIVEWORKSHEETS

TIPE MEMASANGKAN

5) Pasangkanlah gambar berikut ini..

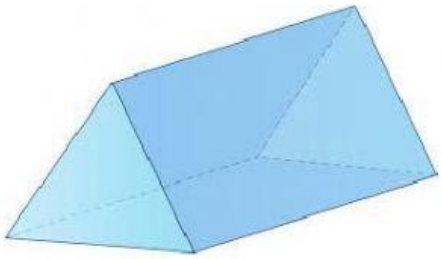

Limas

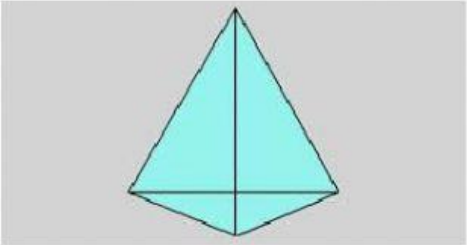

Prisma

SOAL DRAG AND DROP

6) PINDAHKAN BANGUN RUANG DI BAWAH KE KOTAK YANG TEPAT

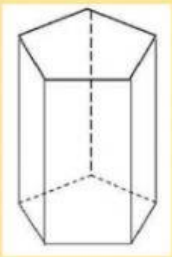

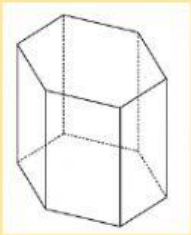

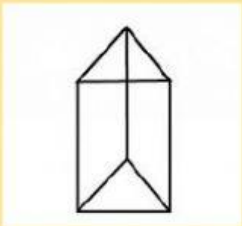

Prisma Segi Tiga

Prisma Segi Lima

Prisma Segi Enam

LIVEWORKSHEETS