Name: _____

Date: _____

Activity 1: Multiplying Group of Equal Numbers

Study each group of pictures. Then write in each box the correct number or word being asked for.

1.

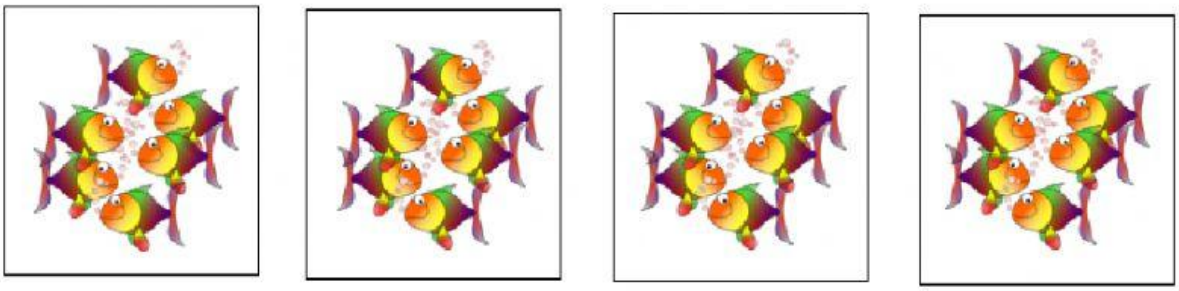

Four groups of [six] = [ ]

four 6s = [ ]

what is the product? [ ]

2.



5 groups of [ ] = [ ]

five 5s = [ ]

what is the product? [ ]

3.



three groups of [ ] = [ ]

three 6s = [ ]

what is the product? [ ]

LIVEWORKSHEETS