Name: _____ Year 1 Bijak

Tuesday 7th February 2022

Chapter 4 – Subtraction within 10

Topic: Subtracting by taking away

1.) Study each picture.
Then, complete the subtraction sentence.



5 – 2 =

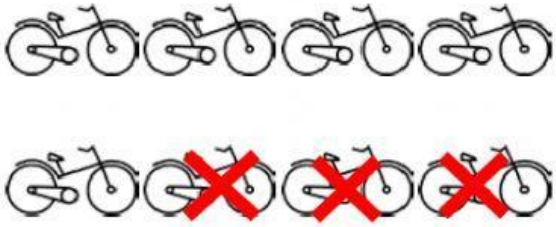

8 – 3 =

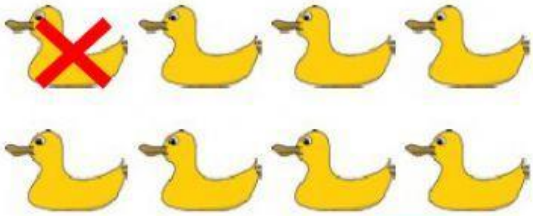

8 – 1 =

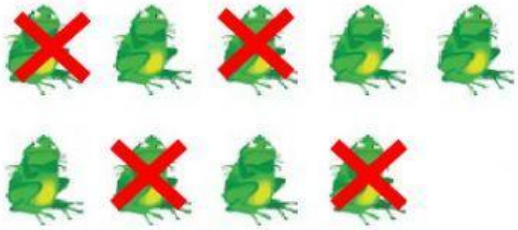

9 – 4 =



6 – 2 =

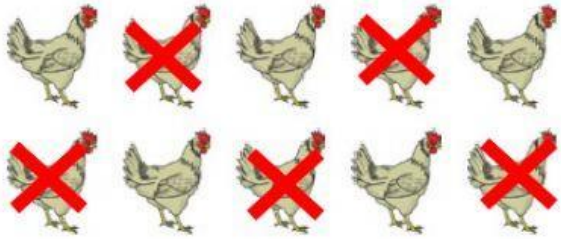

10 – 5 =

LIVEWORKSHEETS

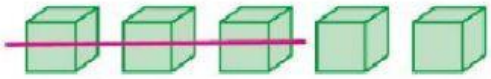

5 - 3 =

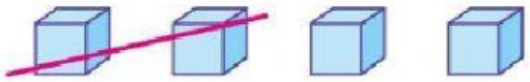

4 - 2 =

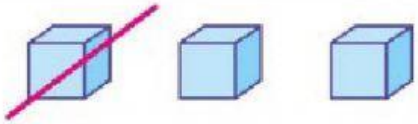

3 - 1 =

8 - 5 =

Subtraction checklist:

I can count to 10			
I can subtract within 10			
I can use pictures or objects to subtract.			

Means you think you did very well

Means you think you did quite well

Means you think you need to do better

LIVEWORKSHEETS