Adierazi irudian agertzen dena zenbakien bitartez

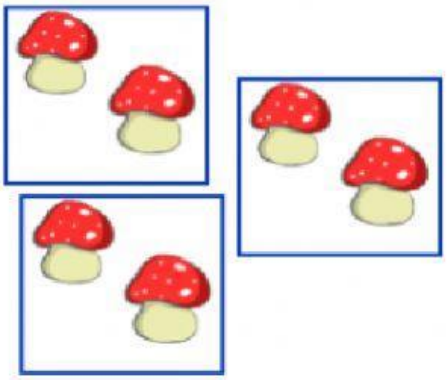

3 bider 2 → 3 x ☐

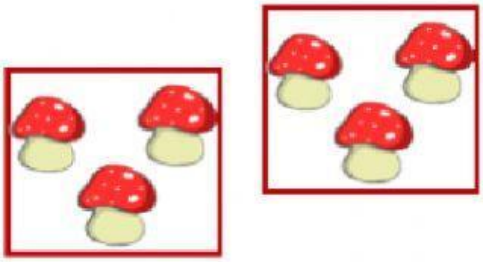

2 bider 3 → ☐ x ☐

2 3

Adierazi irudian agertzen dena zenbakien bitartez

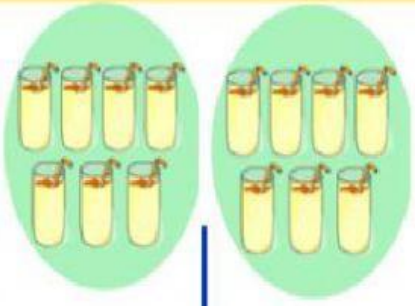

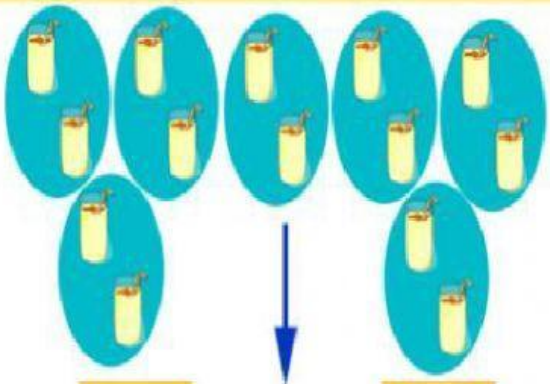

☐ bider ☐

☐ bider ☐

H	B
☐	☐