Mathematics

More than/Less than

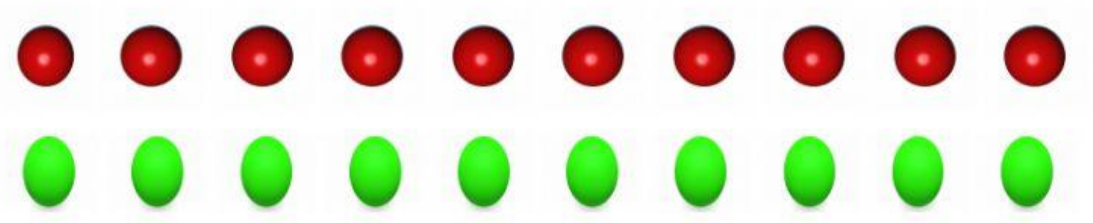

Drag the balls to show the number .

8_____

5_____

Match each ball one to one. Then,

Complete the sentences.



8 is _____ **more** than 5

1	2	3

LIVEWORKSHEETS

Mathematics

More than/Less than

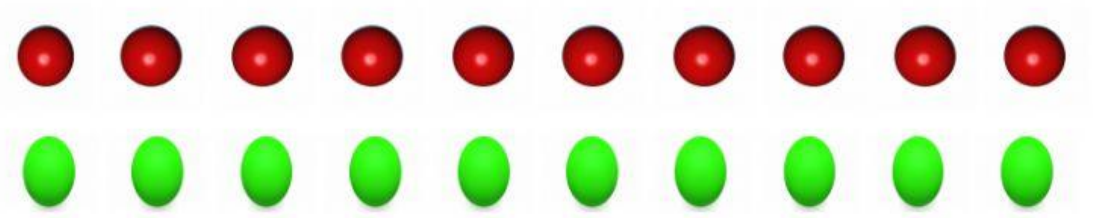

Drag the balls to show the number .

10_____

4_____

Match each ball one to one. Then,

Complete the sentences.



4	6	5

4 is ____ **less** than 10

LIVEWORKSHEETS

Mathematics

More than/Less than

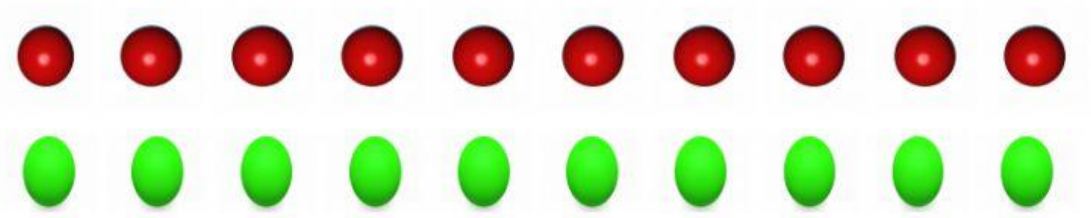

Drag the balls to show the number .

7_____

3_____

Match each ball one to one. Then,

Complete the sentences.



7 is _____ **more** than 3

4	6	5

LIVEWORKSHEETS