Nama: _____ Tarikh: _____

Perbandingan

Berat dan ringan

Pilih objek mana yang lebih **berat**







LIVEWORKSHEETS