GEOGRAFI

LEMBAR KERJA PESERTA DIDIK

Nama :	Kelas :

KOMPETENSI DASAR

3.5 Menganalisis dinamika litosfer dan dampaknya terhadap kehidupan

MATERI

Struktur Lapisan Bumi dan Tektonisme

1. Tuliskan nama-nama lapisan struktur bumi!

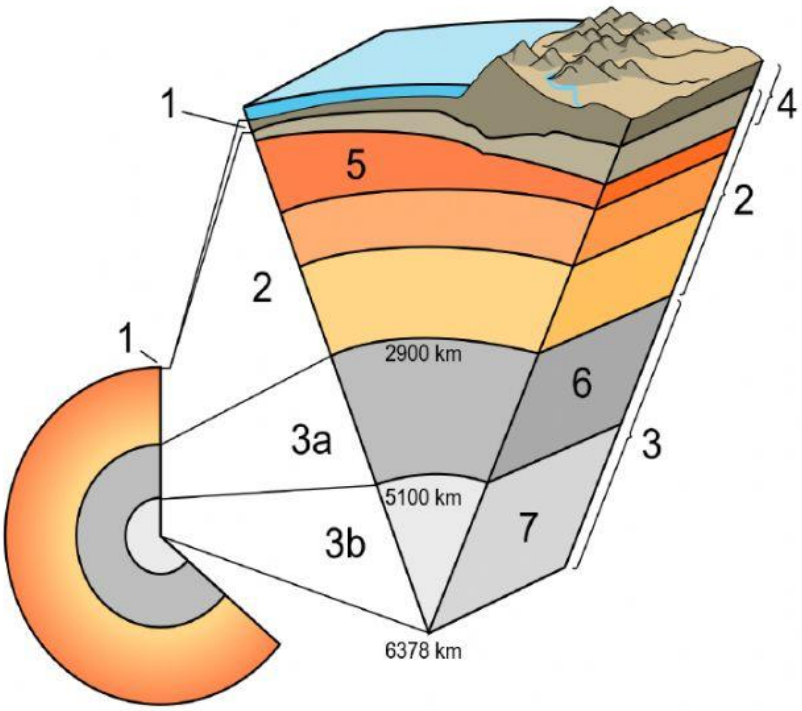

2. Berilah keterangan perbedaan pergerakan epirogenesa dan orogenesa!

Epirogenesa	Orogenesa

LIVEWORKSHEETS

3. **Berilah keterangan pada proses Epirogenesa berikut ini!**

LIVEWORKSHEETS

4. **Berikan analisis pergerakan lempeng tektonik!**

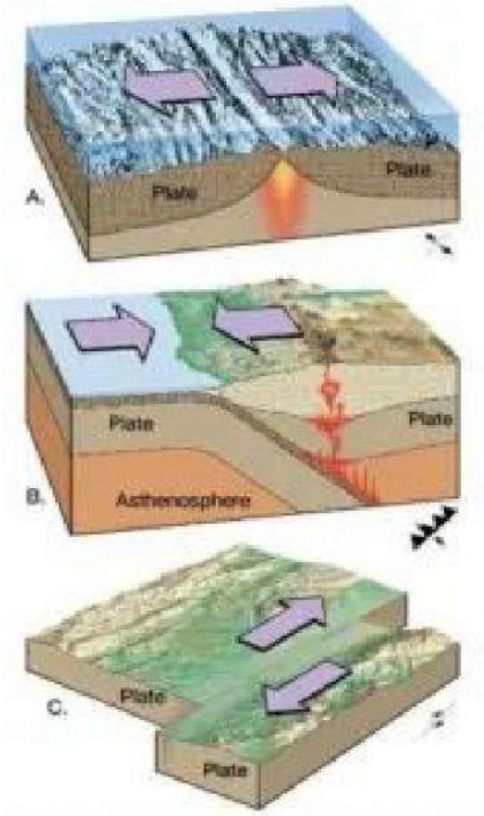

Konvergen

Divergen

Transform

Membentuk Sesar Mendatar

Membentuk zona subduksi

Membentuk tanggul dasar tengah samudera

5. **Berikan keterangan pada jenis patahan berikut!**

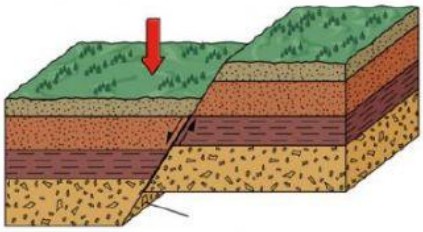

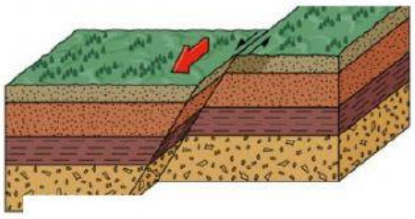

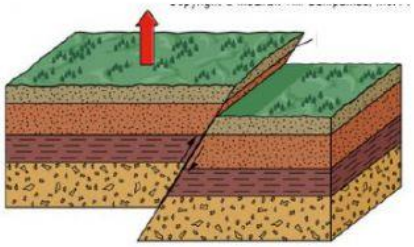

LIVEWORKSHEETS

6. **Berikat keterangan pada lipatan berikut ini!**

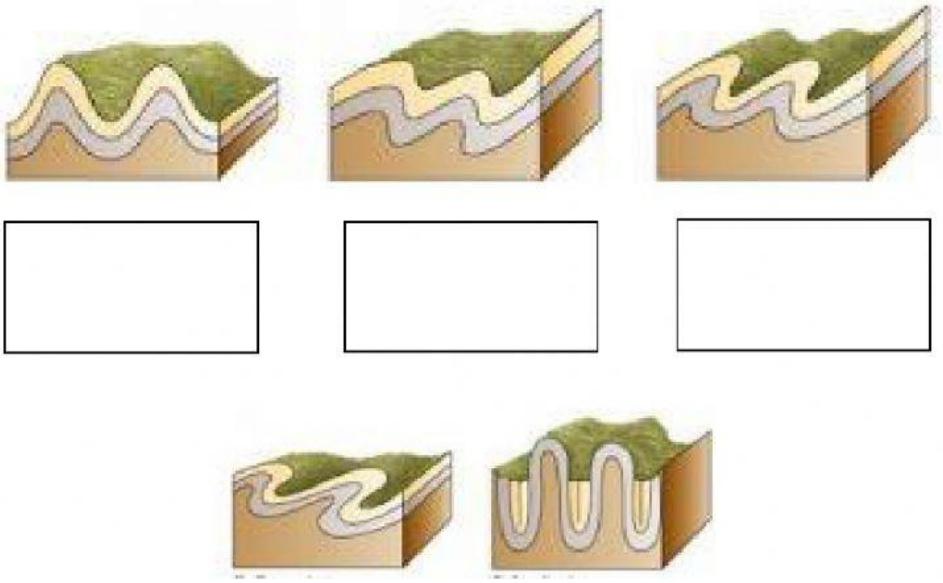

Alhamdulillah….

LIVEWORKSHEETS