ACTIVITY SHEET
MATHEMATICS 1
QUARTER 2-MODULE 5

Pangalan: _____1-_____

Visualizing, Representing and Subtracting One-digit Numbers with Minuends through 18 (basic facts)

Activity No. 1

Panuto: Suriin ang mga larawan sa bawat bilang at isulat ang number sentence sapatlang.

1.

Number Sentence: _____

2. 

Number Sentence: _____

3. 

Number Sentence: _____

4.

Number Sentence: _____

5. 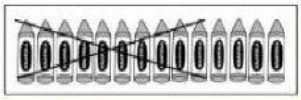

Number Sentence: _____

Activity No. 2

Panuto: Isulat ang nawawalangbilang.

Minuend	13		16	18	11
Subtrahend	7	6		8	
Difference		6	4		5

Activity No. 3

Panuto: Isulat ang tamang sagot.

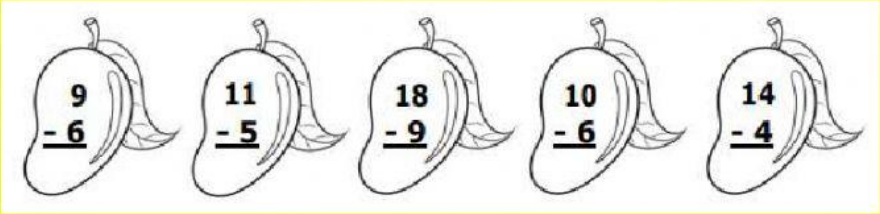

LIVEWORKSHEETS