❶ Señala.

La torre más alta



La bufanda más ancha

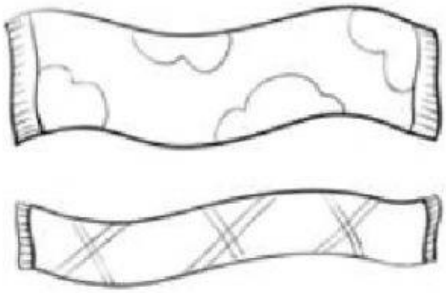

La serpiente más larga



❷ Señala en cada caso lo que más pesa.



LIVEWORKSHEETS

❸ ¿Cuánto mide cada lápiz? Observa y completa.

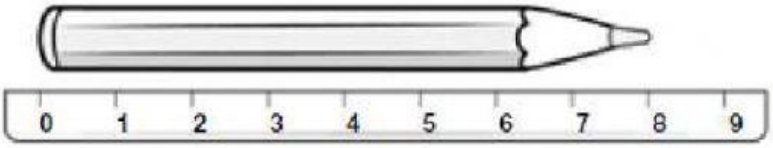

Mide ☐ centímetros.

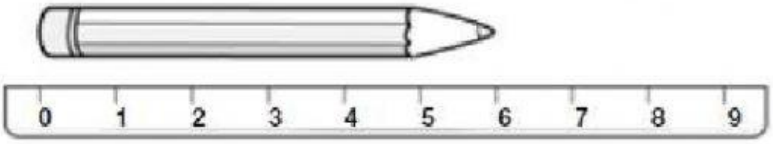

Mide ☐ centímetros.

❹ Calcula las sumas.

3 〉○	2 〉○	5 〉○	8 〉○
4	2	6	2
+ 1	+ 5	+ 2	+ 7
☐	☐	☐	☐

❺ ¿Qué número es? Completa y escribe cómo se lee.



▶ ☐ decenas y ☐ unidades



▶ ☐ decenas y ☐ unidades

LIVEWORKSHEETS

6 ¿Cuánto crees que mide cada objeto? Une.

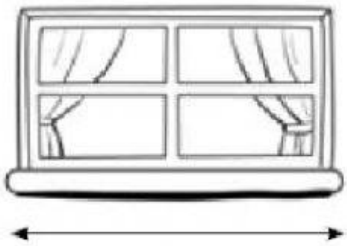

4 palmos

10 palmos



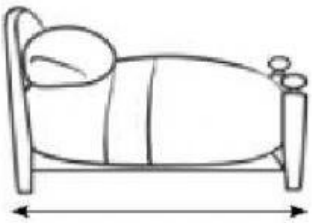

20 pasos

5 pasos

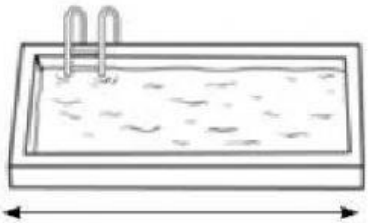

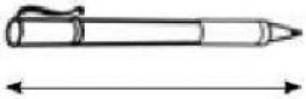

8 centímetros

18 centímetros



7 Escribe el número y cómo se lee.

2 decenas y 2 unidades ▶ ☐ _____

2 decenas y 6 unidades ▶ ☐ _____

2 decenas y 7 unidades ▶ ☐ _____

2 decenas y 8 unidades ▶ ☐ _____

LIVEWORKSHEETS

8 Calcula las sumas.

7 + 8 = ☐ 10 + 9 = ☐ 5 + 7 + 2 = ☐

2	5	8	9
2	6	2	4
+ 5	+ 2	+ 7	+ 5
☐	☐	☐	☐

9 Lee y resuelve.

Ana tiene 3 pulseras rojas, 5 amarillas y 2 de color marrón.
¿Cuántas pulseras tiene en total?

☐
☐
+ ☐
☐

Solución ▶ _____

10 Señala en cada caso el paquete que pesa más de un kilo.

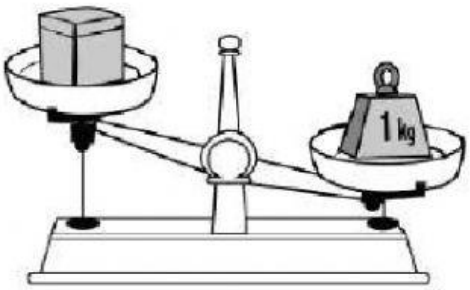

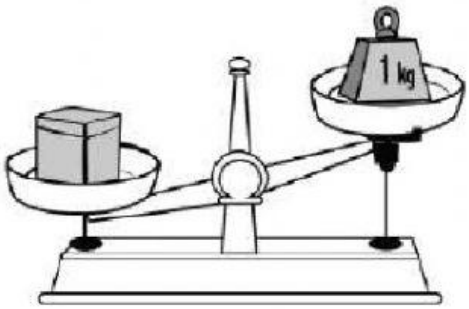

LIVEWORKSHEETS