Сума кутів трикутника
Зовнішній кут трикутника

№1

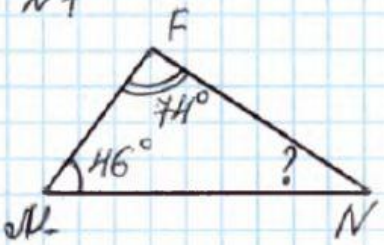

№2

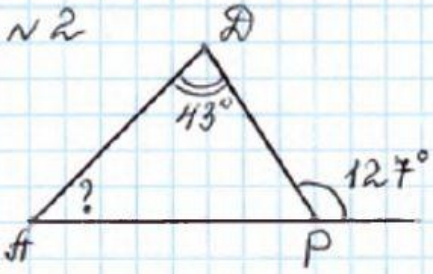

№3

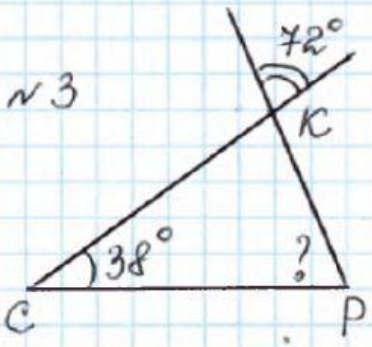

№4

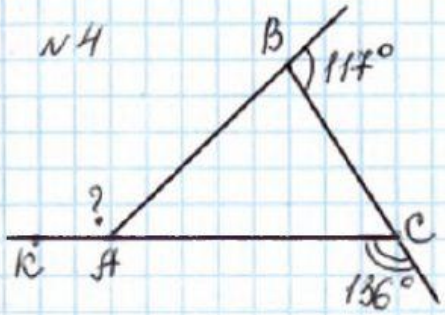

№5

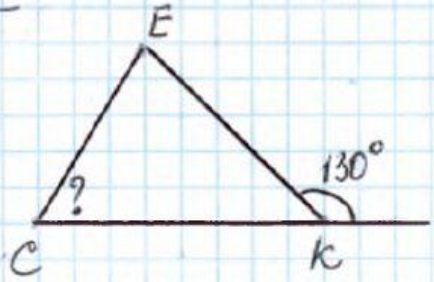

$\angle E$ - ?, на 30° б

$\angle C$ - ?

№6

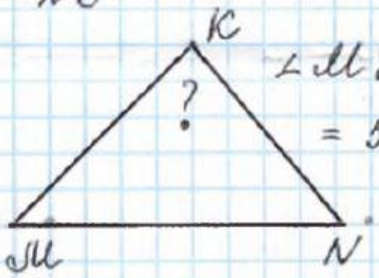

$\angle M : \angle K : \angle N =$
$= 5 : 7 : 3$

№7

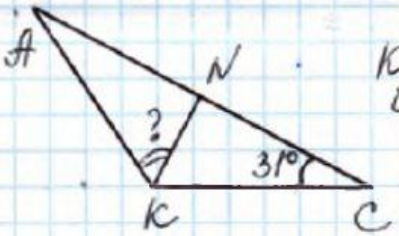

KN - висота і бісектриса

№8

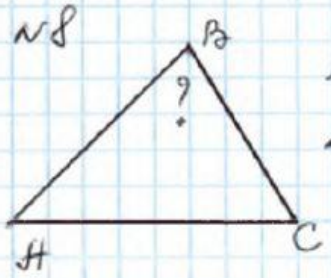

$\angle A + \angle B = 100°$

$\angle B + \angle C = 120°$

№9

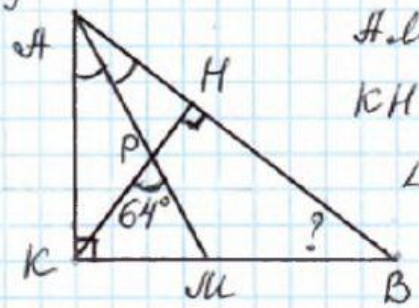

AM - бісектриса

KH - висота

$\angle AKB = 90°$

№10

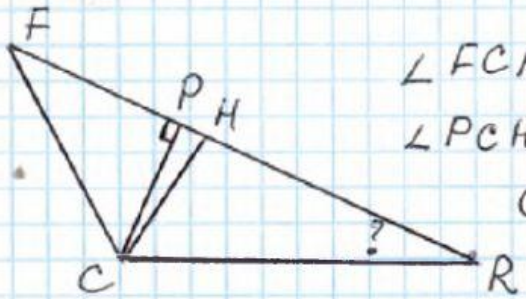

$\angle FCR = 130°$

$\angle PCH = 15°$

CH - бісектриса $\angle FCR$

LIVEWORKSHEETS