Polinomios

Identifica los términos semejantes teniendo en consideración la letra y el exponente como en el siguiente ejemplo:

$$(12x^2 + 3x + 5y) + (12x^2 + 5x + 2y)$$

$$8x + 7y + 24x^2$$

EXPONENTE

a. $(12xy + 34xyz + 9x^2) + (2x^2 + 2xy + 2xyz)$

b. $(xy + 5x + 3x + 8) + (2xy + 8)$

c. $8x + 8x$

LIVEWORKSHEETS

d. $2x^2 + 3xy^2 + 9x^2 + 3xy^2$



e. $2c^2 + 2x^2 + 2x^2 + 2c^2 + 3y$

f. $9x + 4xyz + 3x^2 + 7x$



g. $x^2 + x^2 + 2x + 5x$



LIVEWORKSHEETS