Name: _____ Date: _____

Hugh W. Campbell Primary School
Grade 3
Mathematics – Assessment Tool 2022
(40pts)

A.Find the sum or difference.

a. 15 + 6 = _____ b. 25 - 5 = _____

(1pt each = 2pts)

B. Find the sum or difference.

a. 3 1
+2 0
_____

b. 4 4
-1 3
_____

c. 2, 5 7 1
+1, 2 3 5
_____

d. 4 6 8
+3 3 1
_____

e. 8 3 9
-2 5 6
_____

f. 3, 5 7 0
- 1, 4 3 5
_____

(1pt each = 6pts)

C.Read each question carefully. Write the correct place value on the line.

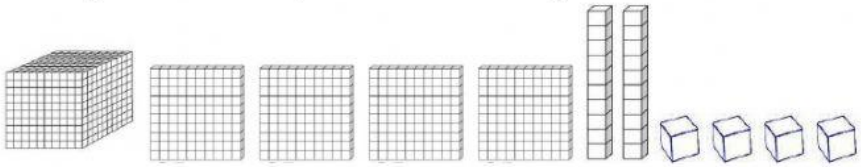

Write the expanded form for the model: _____

Write the **word form** or the **standard form** to complete the chart. **(3pts)**

Words	**Numbers**
one hundred fifty	
	5,108
fifty-eight	
	113

LIVEWORKSHEETS

Write the **place** of the underlined digits in each number below. **(2pts)**

826 _____ 6,2**3**5 _____

Write the **value** of the underlined digits in each number below. **(2pts)**

8,763 _____ 14,**5**72 _____

Complete the chart. Write the **missing numbers** for each row. **(2pts)**

A.		40	41
B.	198	199	

Write the numbers on the chart in order from least to greatest. **(2pts)**

431	**433**	**403**	**413**

Answer: _____ _____ _____ _____

Complete the number pattern below. **(2pt)**

5		**15**		**25**

Draw a circle around the third apple. Put an X on the sixth apple. **(2pt)**

Compare the amounts. Write ≤, ≥ or =. **(3pts)**

18 _____ 27 108 _____ 98 235 _____ 235

Write the names the of plane shapes. **(3pts)**

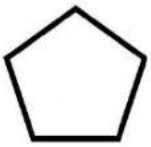

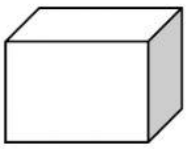



_____ _____ _____

LIVEWORKSHEETS

D.Read carefully. Solve. Complete all questions correctly.

1.Fisherman Brown collected 13 conchs from his traps on Monday. On Tuesday he collected 15 conchs. What is the total amount of conchs Fisherman Brown collected both days?

Answer: _____(1)



2.Mrs. Jane the Art teacher spent 384 on paint and 215 on brushes. How much money did she spend altogether?

Answer: _____(2)

3.Mark has 174 flamingos in the pond. 123 of them flew away. How many flamingos remained in the pond?

Answer: _____(2)

4.If a number has **2** in the hundreds place, **3** in the ones place and **4** in the tens place:

(a) What is the number?

Answer: _____(1)

(b) Write the number in **expanded form.**

Answer: _____(1)

(c) Write the **word form** for the number.(1)

_____

_____

5.Bill's jigsaw has 4,236 pieces. Bill can only find 2,105 pieces of the jigsaw. How many pieces of the jigsaw are still missing? (3pts)

Answer: _____

LIVEWORKSHEETS