Измерване на дължина в сантиметри

Измери с помощта на линията и запиши дължината на всеки предмет:

1)

_____

2)

_____

3)

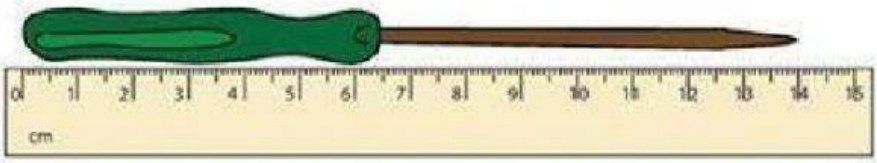

_____

4)

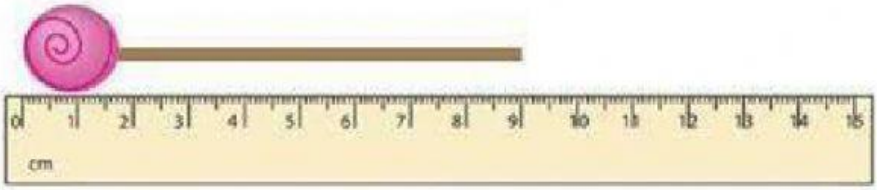

_____

5)

_____

Каква е дължината на бонбона?



Каква е дължината на пчелата?
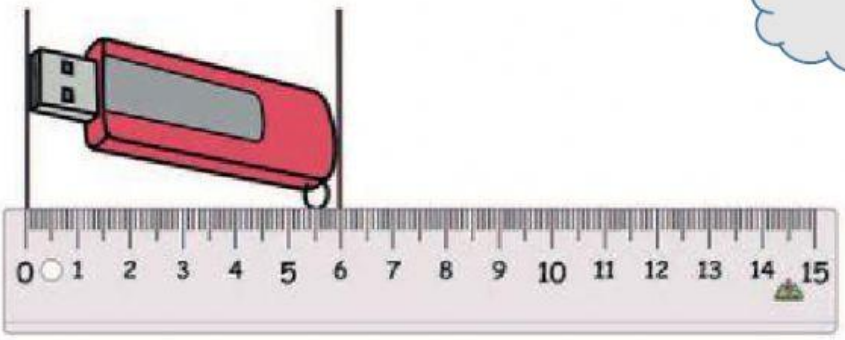
Каква е дължината на това устройство?