Mixed Numbers and Improper Fractions

Write an improper fraction and a mixed number for each model.

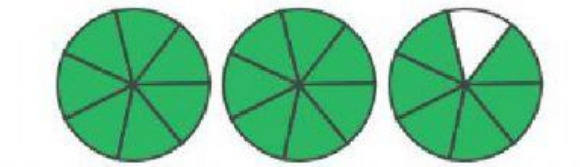

Improper		Mixed #
_____	=	_____

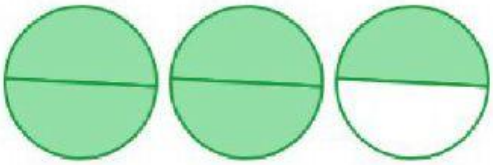

_____	=	_____

LIVEWORKSHEETS

	Improper		Mixed #
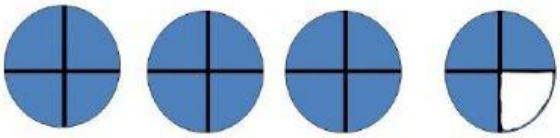	_____	=	_____
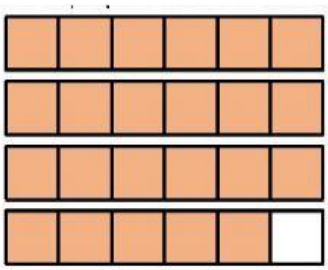	_____	=	_____
	_____	=	_____

LIVEWORKSHEETS

	Improper		Mixed #
	_____	=	_____
	_____	=	_____
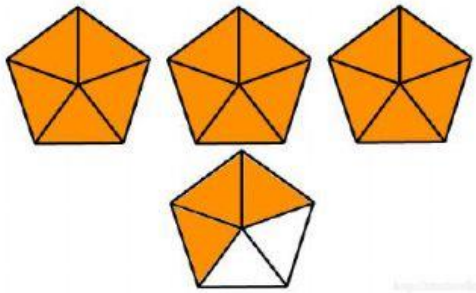	_____	=	_____

LIVEWORKSHEETS