اسم الطالبة

السؤال الأول : أوجد مجال ومدى الدوال التالية :

Quadratic: $f(x) = x^2$

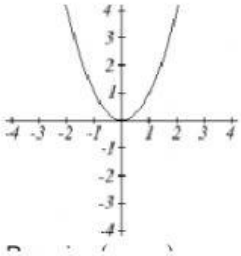

مجال :

مدى :

Square root: $f(x) = \sqrt{x}$

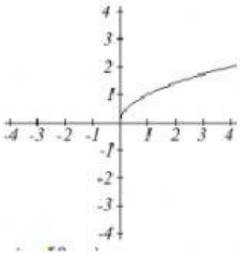

مجال :

مدى :

Absolute Value: $f(x) = |x|$

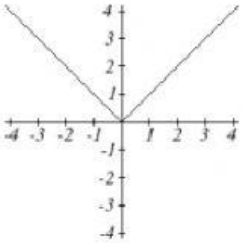

مجال :

مدى :

LIVEWORKSHEETS