RISTKÜLIKU JA RUUDU ÜMBERMÕÕT

1. **Märgi õiged valikud.**

Ristkülik ja ruut on tasapinnalised / ruumilised geomeetrilised kujundid.

Ruut on kolmnurk / nelinurk.

Ruudu kõik küljed on võrdse / erineva pikkusega.

Ristküliku vastasküljed on võrdse / erineva pikkusega.

Ruut ja ristkülik on nelinurgad, mille nurgad on teravnurgad / täisnurgad / nürinurgad.

Ruut on lahtine / kinnine murdjoon.

2. **Vaata joonist ja arvuta peast ümbermõõt P.**

P = a + a + a + a

P = 4 · a



P = ... (cm)

P = 2·a + 2·b

P = 2 · (a+b)



P = ... (cm)



P = ... (cm)

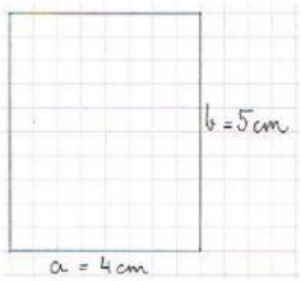

P = ... (cm)

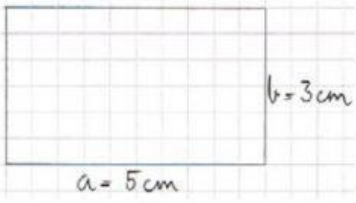

P = ... (cm)

LIVEWORKSHEETS