Gingerbread Man Counting Review

Count the items in the box, choose the correct number.

1 12 9



11 10 2



2 10 6



13 2 11



15 12 3



5 20 16

Ms.H

LIVEWORKSHEETS