مدرسة النخيل
PALMS SCHOOL
BAHRAIN

Practice sheet

Changing states of water

Fill in each blank with heated or cooled.

Ice changes to water when it is _____.

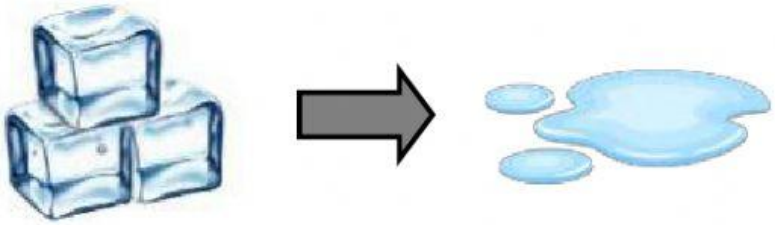

Water changes to water vapor when it is _____.

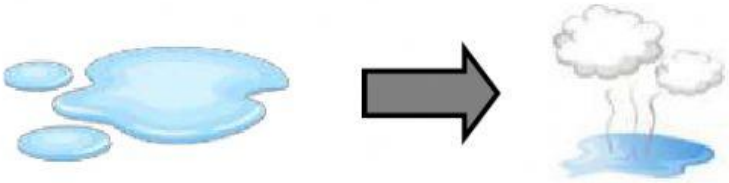

Water vapor changes to water when it is _____.



Water changes to ice when it is _____.

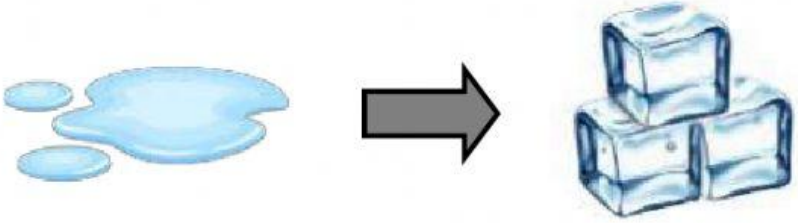

LIVEWORKSHEETS

Changing states of matter

Fill in the blanks.

water vapor	solid	ice
gas	liquid	heated

Water turns to _____ when it freezes.
It turns from a _____ to a solid.

When water is heated enough, it becomes _____.
It turns from a liquid to a _____.

When ice is _____ it turns to water.
It changes from a _____ to a liquid.

LIVEWORKSHEETS

LIVEWORKSHEETS

LIVEWORKSHEETS