Bé đếm số lượng vật và chọn số tương ứng nhé.



15 | 10 | 13



12 | 14 | 11



15 | 18 | 12

12 | 14 | 16

19 | 17 | 15



18 | 16 | 20

LIVEWORKSHEETS

Bé đếm số lượng vật và điền số tương ứng nhé.



LIVEWORKSHEETS