Geometrik Cisimler

6. Aşağıdaki geometrik cisimlerin altlarına isimlerini yazalım

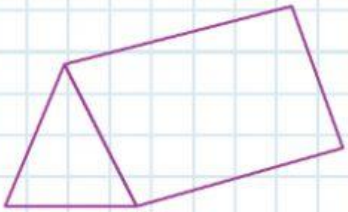

.....

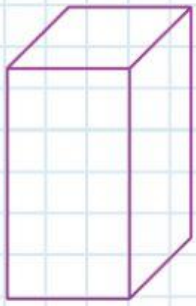

.....

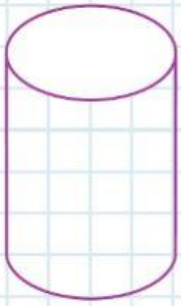

.....

.....

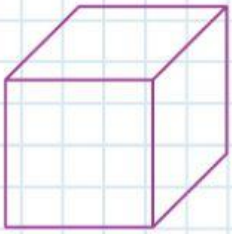

.....

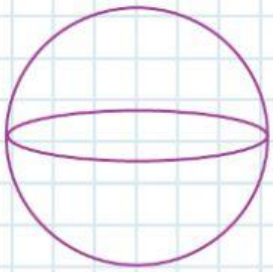

.....

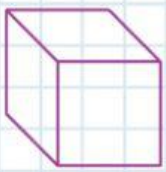

.....

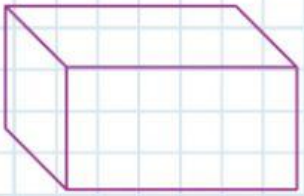

.....



.....

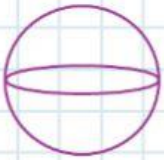

.....

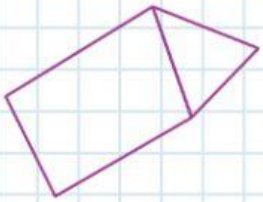

.....

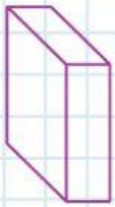

.....

LIVEWORKSHEETS