





1. How much do the fox and the snake weigh?
2. How much does the fox weigh?
3. How much does the snake weigh?
4. How do you know?

5. How much do the grasshopper and bee weigh?
6. How much does the grasshopper weigh?
7. How much does the bee weigh?
8. How do you know?

LIVEWORKSHEETS







9. How much do the ice cream and chocolate syrup weigh?

10. How much does the chocolate syrup weigh?

11. How much do the two cartons of ice cream weigh?

12. How much does one carton of ice cream weigh?

13. How many bottles of chocolate syrup are equal to the weight of one carton of ice cream?

14. How much do the chips and cookies weigh?

15. How much do the cookies weigh?

16. How much do the two bags of chips weigh?

17. How much does one bag of chips weigh?

18. How many bags of chips are equal to the cookies?

LIVEWORKSHEETS

Look at the pictures and choose the correct answer.

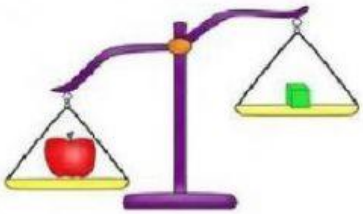

19. The apple is the block.

20. The apple is the watermelon.

21. The block is the watermelon.

22-23 Drag the pictures to fill in the scale.

LIVEWORKSHEETS