Nickname: Quiz

Part 1: Match the time with the clock.

7:40

1:15

6:05

5:10

8:20

10:45

LIVEWORKSHEETS

Part 2: Write the elapsed time on the space provided.

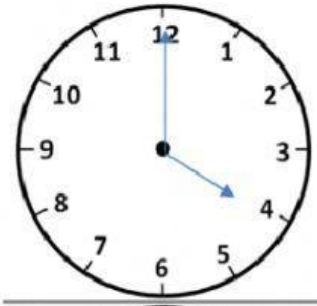
TO

30 minutes

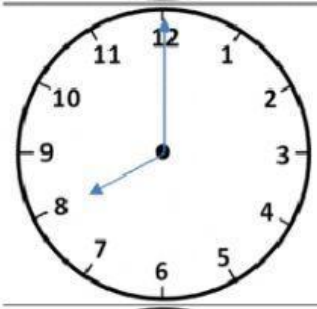
TO
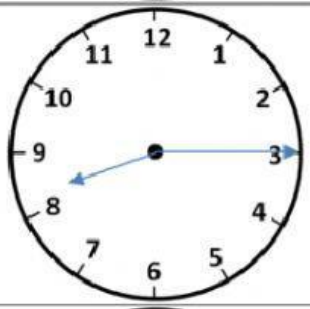

_____ minutes

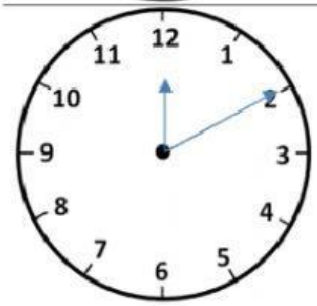
TO
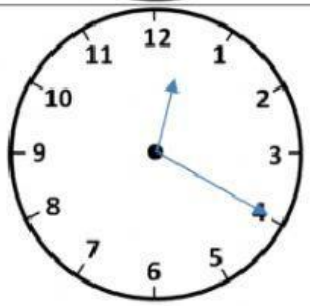

_____ minutes

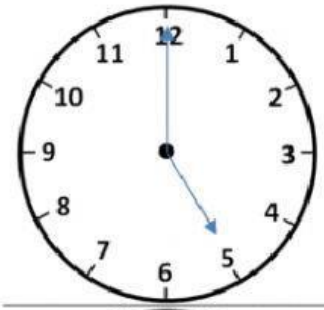
TO
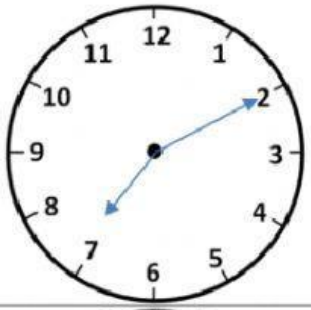

___ hours ____ minutes

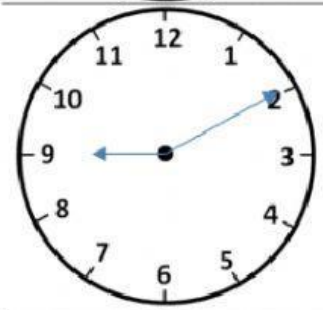
TO

___ hours ____ minutes

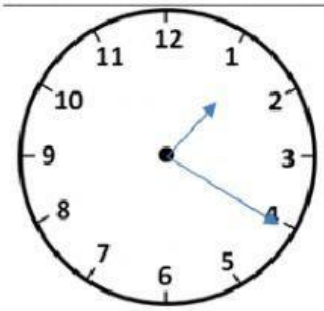
TO
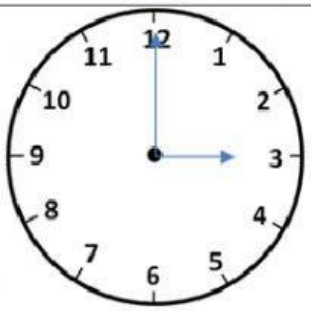

___ hours ____ minutes

LIVEWORKSHEETS

Part 3: Write the correct conversion for each given time.

4 hours =	240 minutes	300 minutes	180 minutes
240 minutes =	5 hours	4 hours 30 minutes	4 hours
360 minutes =	6 hours	8 hours	2 hours
7 hours =	410 minutes	420 hours	420 minutes
600 minutes =	10 minutes	10 hours	10 hours 10 minutes
11 hours =	642 minutes	665 minutes	660 minutes

LIVEWORKSHEETS