Name _____ Date _____

Grade _____

Find the area of the given circle
Please put the simplified version and the number rounded to the nearest hundredth

1.

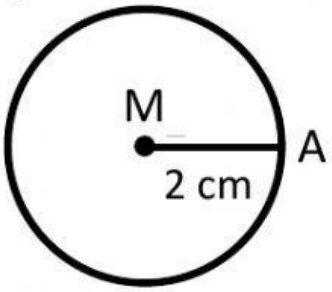

$Answer =$ _____ cm^2

4.

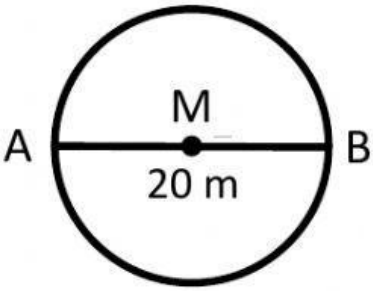

$Answer =$ _____ cm^2

2.

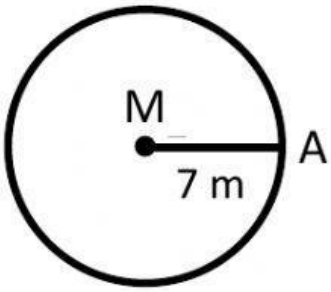

$Answer =$ _____ cm^2

5.

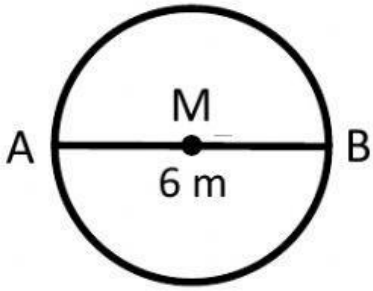

$Answer =$ _____ cm^2

3.

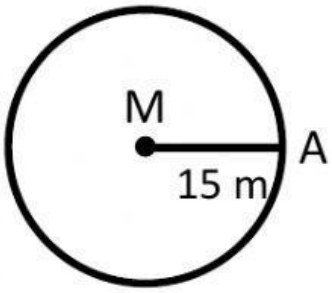

$Answer =$ _____ cm^2

6.

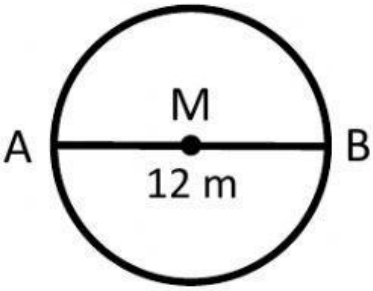

$Answer =$ _____ cm^2

LIVEWORKSHEETS