Evaluamos nuestros aprendizajes en Matemática

Halla el perímetro y área de las siguientes figuras:

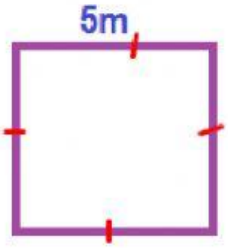

P= _____m

A=_____m^2



P= _____m

A=_____m^2

Halla la medida del ángulo desconocido:

1. Calcular α

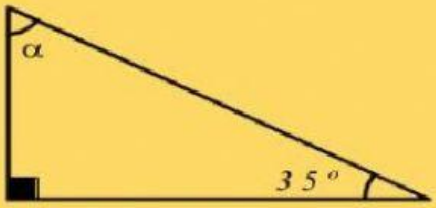

°

2. Calcular β

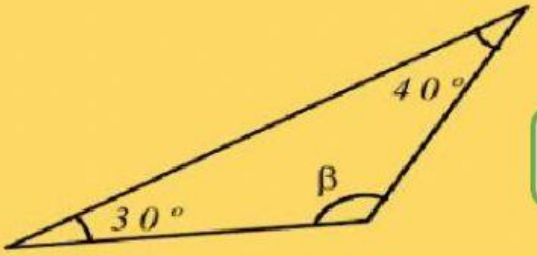

°

LIVEWORKSHEETS

Selecciona el nombre del elemento según indica :

Coloca la medida del ángulo desconocido:

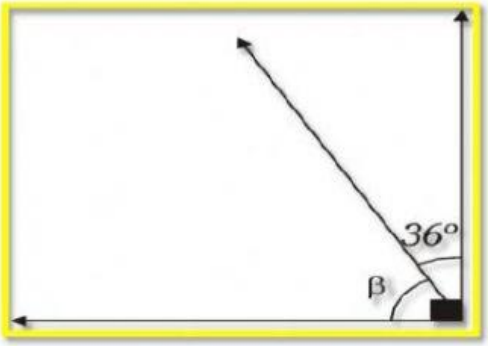

°

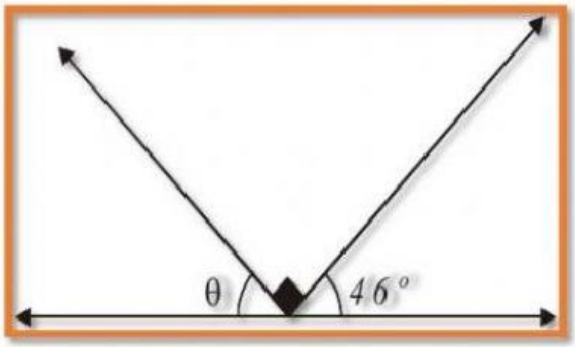

°

LIVEWORKSHEETS