POLIGONO BATEN PERIMETROA

Kalkulatu poligono hauen perimetroak:

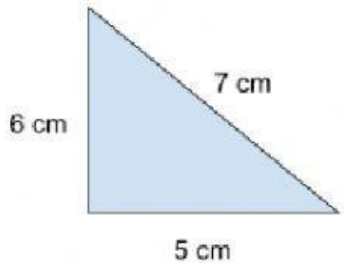

___ + ___ + ___ =

= ___



___ + ___ + ___ + ___ =

= ___

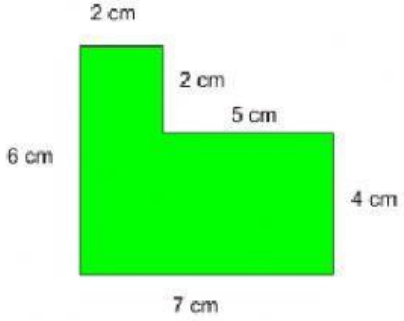

___ cm

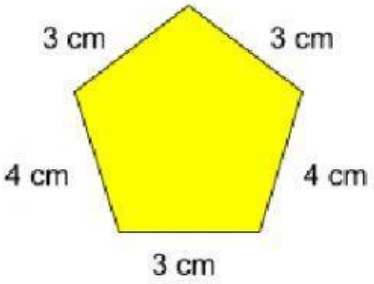

___ cm

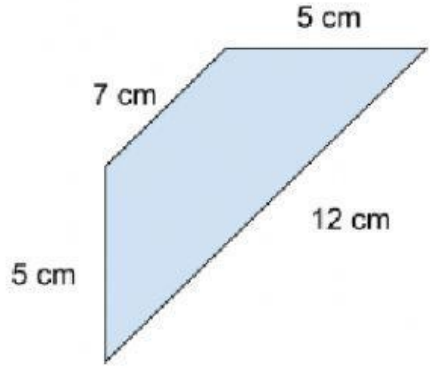

____ cm

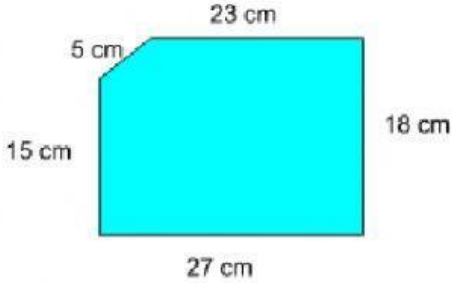

___ cm

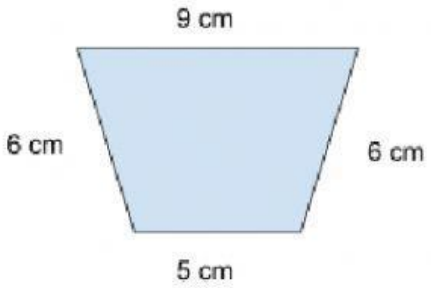

___ cm

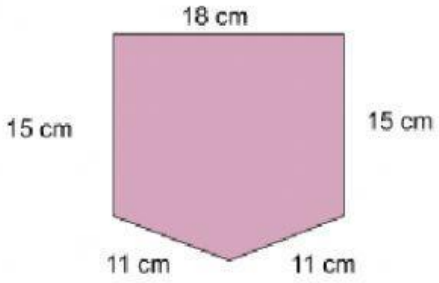

___ cm

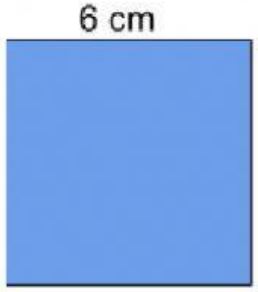

___ cm

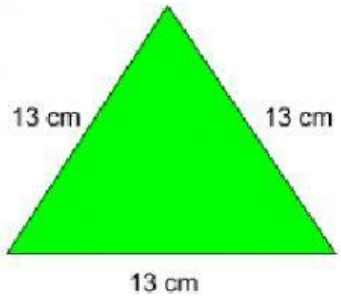

___ cm

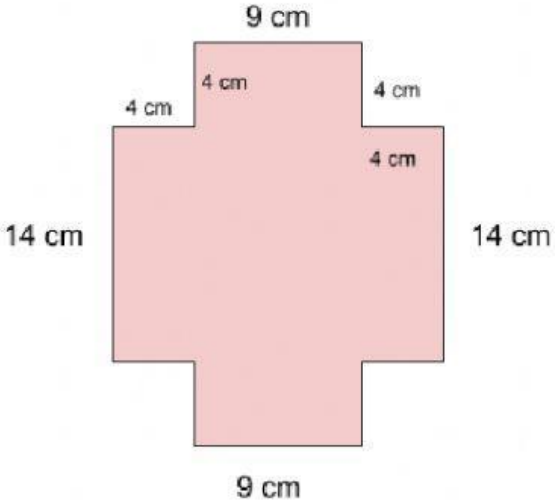

___ cm

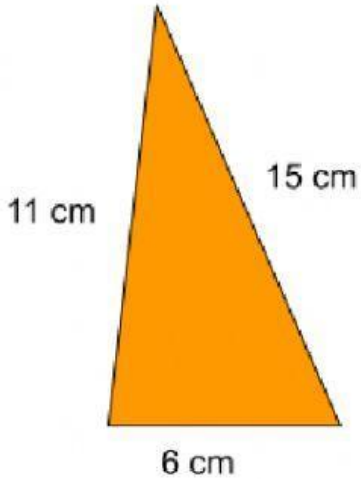

___ cm

Liernik 15cm-ko aldea duten lauki formako 3 irudi ditu eta marko bana ipini nahi die.

- Zenbat zentimetro listoi beharko ditu?

- 2 metro listoi erosi baditu zenbat zentimetro sobratuko zaizkio?

- 2 metro eta 40 cm listoirekin, lauki formako zenbat argazkiri jar diezaioke markoa?

Markelek laukizuzen formako lurtsail bat du, 60 metro eta 25 metro luze diren aldeak dituena. Lursailari hesia jarri dio. Zenbat metro hesi erabili ditu?