3 **Tính nhẩm.**

20 cm – 4 cm = ... 100 cm – 40 cm = ...

18 dm – 9 dm = ... 90 dm – 30 dm = ...

4 **Nối** (theo mẫu).

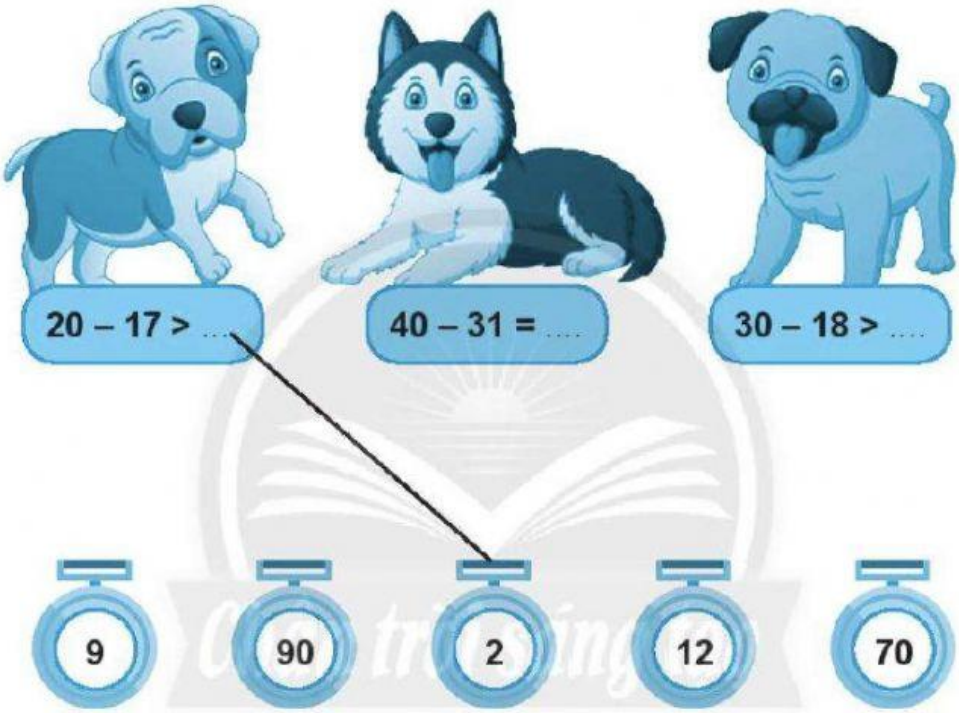



LIVEWORKSHEETS

5

Anh Bi cao **90** cm.

Bé Na thấp hơn anh Bi **18** cm.

Hỏi bé Na cao bao nhiêu xăng-ti-mét?



6

Lúc đầu có **60** con bướm,

sau đó **28** con bay đi.

Hỏi còn lại bao nhiêu

con bướm?

LIVEWORKSHEETS