EXCELSIOR INTERNATIONAL SCHOOL

MATH CLASS

III TRIMESTER

Teacher Daniela Moreno

Student's name:_____ Level: 3 score: 50

I- A.M. and P.M. Look at the clock and choose the correct answer. 12pts

IT'S ONE O'CLOCK

IT'S SIX O'CLOCK

IT'S TWO O'CLOCK

IT'S TEN O'CLOCK

IT'S SEVEN O'CLOCK

IT'S FIVE O'CLOCK

IT'S FOUR O'CLOCK

IT'S ELEVEN O'CLOCK

IT'S THREE O'CLOCK

IT'S TWO O'CLOCK

IT'S NINE O'CLOCK

IT'S EIGHT O'CLOCK

IT'S FIVE O'CLOCK

IT'S TWELVE O'CLOCK

IT'S TWO O'CLOCK

IT'S TWO O'CLOCK

IT'S ONE O'CLOCK

IT'S SIX O'CLOCK

LIVEWORKSHEETS

II. Time to the minute: drag the names to correctly label the analogue clock. 10pts

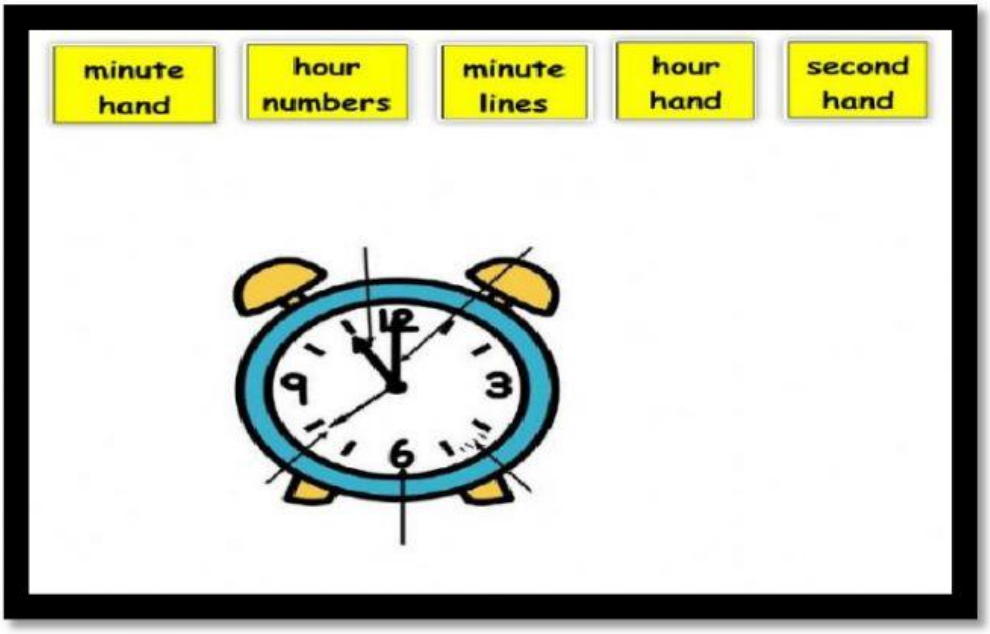

III-Measure Length: write the correct length 14pts

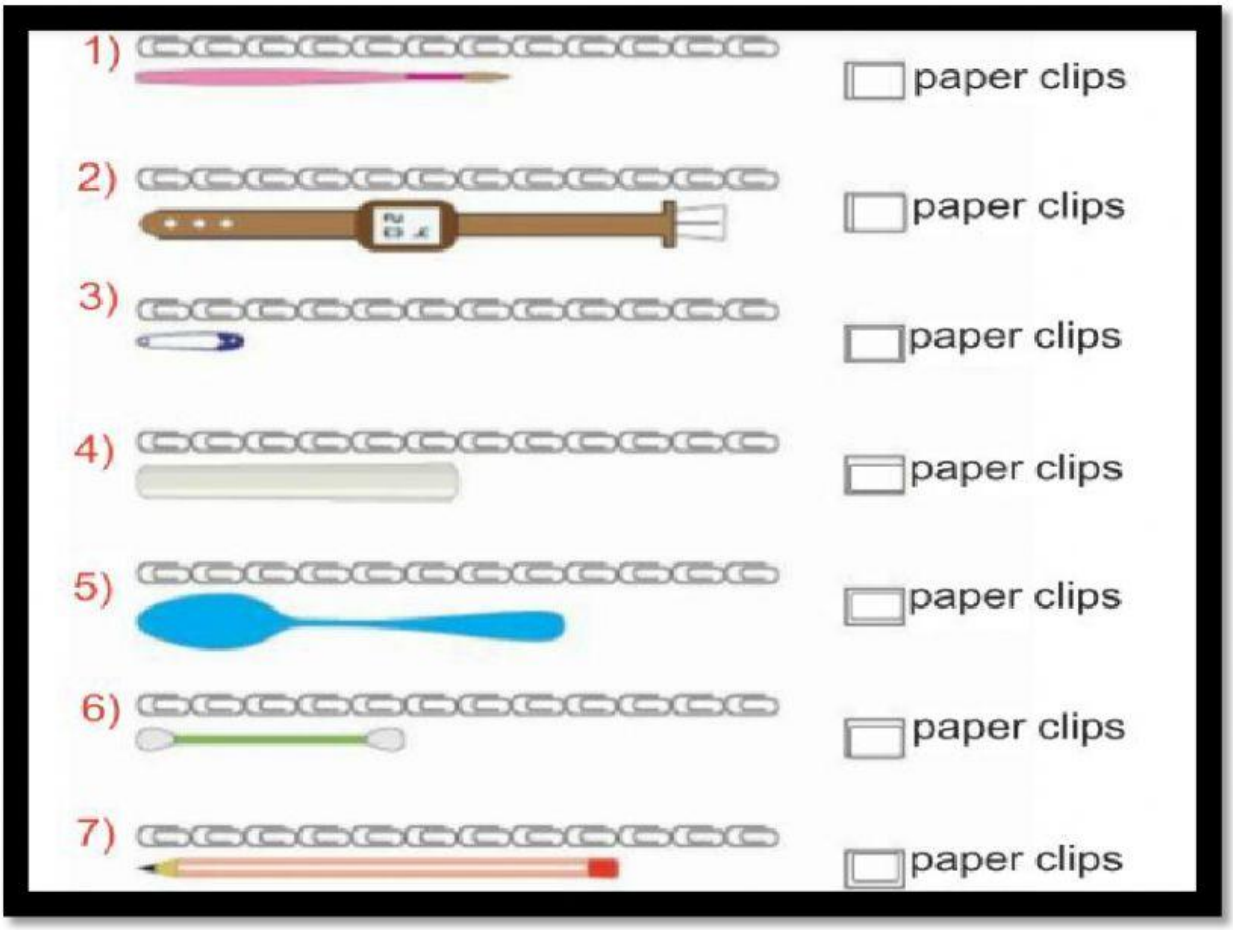

LIVEWORKSHEETS

IV. Volume and Liquids.: Estimate how much liquid there will be when the container is filled. WRITE **MORE THAN 1 LITER**, **ABOUT 1 LITER**, or **LESS THAN 1 LITER** 12pts

1) cup of coffee

_____

2) dump truck

_____

3) soda bottle

_____

4) glass of water

_____

5) juice

_____

6) bathtub

_____

V. Problem Solving

Peter pour water into four glasses that are the same size. 2pts

- Which glass has the least amount of water?

- Which glass has the most amount of water?

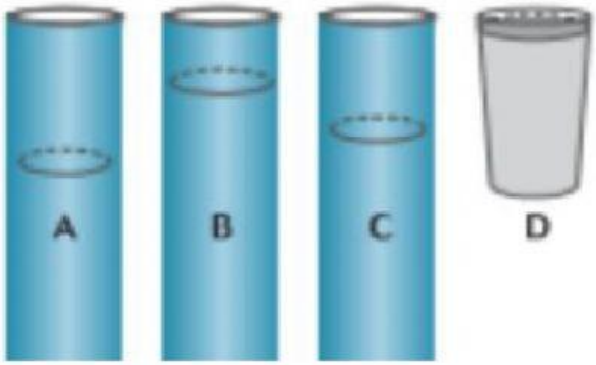

Good Luck!

LIVEWORKSHEETS