# PRISMAS

# PIRÁMIDES

## 1. Completa con los elementos de cada figura:

vértice | cara

vértice | cara

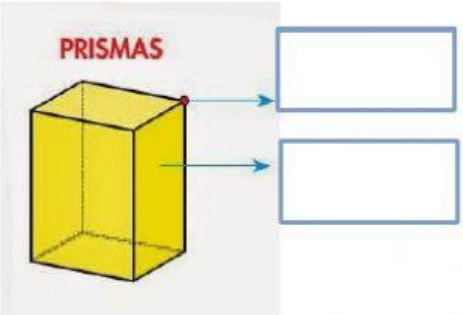


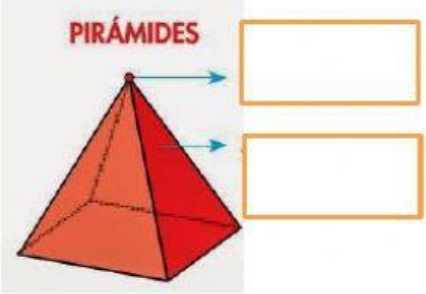


## 2. Une con flechas.

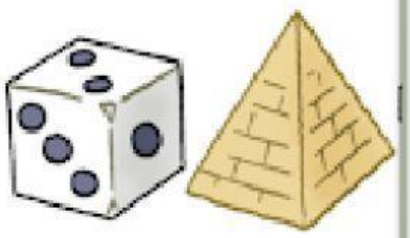

PRISMA

PIRÁMIDE

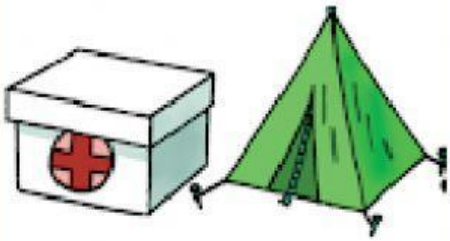

PRISMA

PIRÁMIDE



PRISMA

PIRÁMIDE