POLYGONS - Angles: Triangles

Question 1: Find the size of each missing angle.

(a)

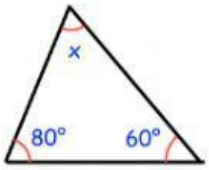

(b)

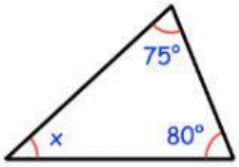

(c)

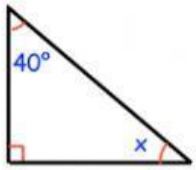

(d)

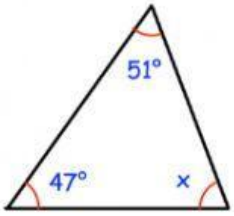

(e)

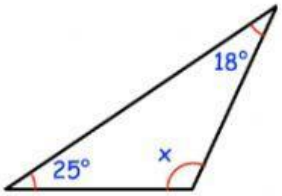

(f)

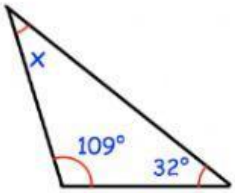

50^0	39^0	137^0	40^0	25^0	82^0

Question 2: Find the size of each missing angle.

(a)

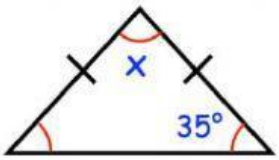

(b)

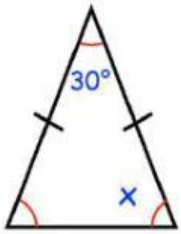

(c)

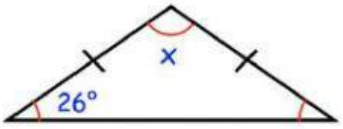

(d)

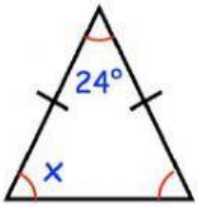

(e)

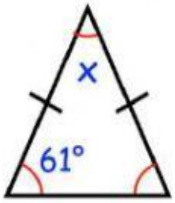

(f)

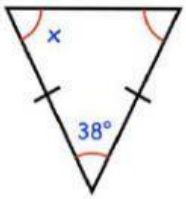

128^0	110^0	58^0	65^0	71^0	75^0	78^0

Apply-Question 3: Jacob has measured the three angles in a triangle. Two of his measurements are 45° and 70°. What is the third measurement? Ans: _____ [Drag the answers for Question 2 & 3 are in the table above.}

Upload your Image after you've checked your answers via Class Point or Line Id: gpower11. By T.OJO

LIVEWORKSHEETS