Fraction Shapes

Write the fraction for the shaded area of each shape.

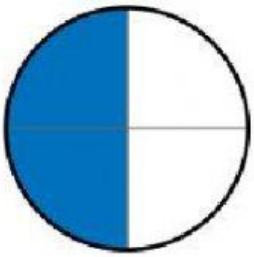

_____



_____



_____

_____

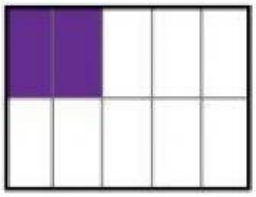

_____

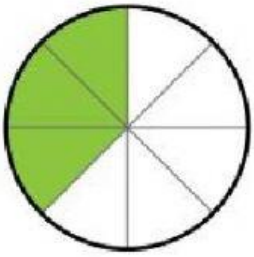

_____



_____



_____

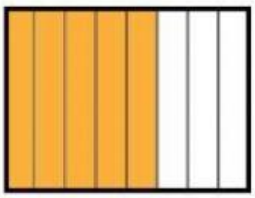

_____



_____

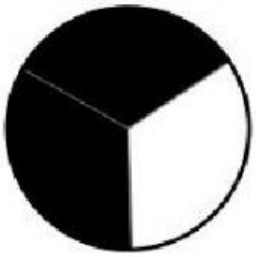

_____



_____

LIVEWORKSHEETS
LIVEWORKSHEETS