ĐỀ CƯƠNG ÔN TẬP MÔN MATHS – 2A5

Question 1 : where is number 85 ?

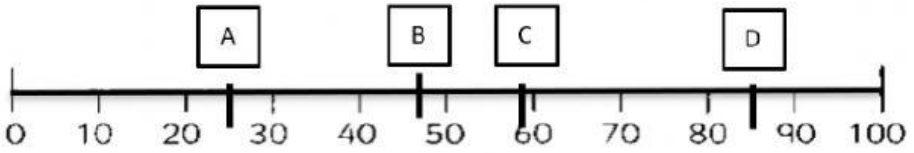

a. A b. B c. C d. D

Question 2. 3. The ♡ card is number pairs to 20.

a. 7 b. 8 c. 20 d. 13

Question 3 : Find the missing number in the triangle.

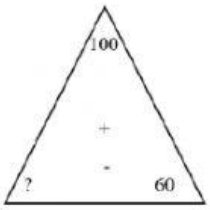

a. 30 b. 40 c. 50

Question 4: Find number pair of 20 :

a. 19 + 2 b. 19 + 1 c. 19 + 3

Question 5 : Find the midpoint number :

10 11 12 13 14 15 16 17 18 19 20

a. 10 b. 15 c. 20

Question 6 : What number is it ? **20**

a. Ten b. twelve c. twenty

Question 7 : Which number is Less than 75 and More than 60 ?

a. 65 b.80 c. 90

Question 8 : Find number pairs of 30 :

a. 20 + 3 b.10 + 10 c. 20 + 10

LIVEWORKSHEETS

Question 9 : Find the missing number :

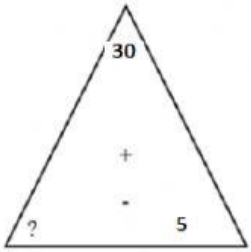

a. 20 b. 15 c. 25

Question 10 : Where is number 99 ?

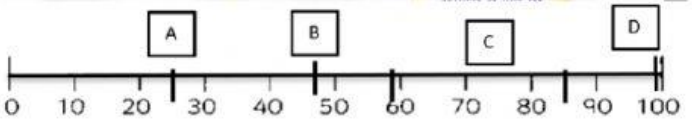

a. A b. B c. C d. D

Question 11 : How many dots are there ?

●●●●●●●●●●
●●●●●●●●●●
●●●●

a. 25 b. 24 c.23

Question 12 : What is the next number ?

12 , 14 , 16 ,18,.....22,.....26

a. 12, 14 , 16 , 18 , 20 , 22 , 24 , 26
b. 12, 14 , 16 , 18 , 19 , 22 , 23 , 26
c. 12, 14 , 16 , 18 , 20 , 22 , 25 , 26

Question 13 : What is the midpoint number ?

20, 21, 22, 23 , 24 , 25 , 26 ,27 , 28, 29 , 30

a. 20 b. 25 c. 29

Question 14 : Find the equal of : **15 + 5 =**

A. 10 + 5 B. 5 + 20 C. 10 + 10

LIVEWORKSHEETS

Question 15 : What is **17** rounded to the nearest 10?

a. 15 b. 10 c. 20

Question 16 : What is **89** rounded to the nearest 10?

a. 80 b. 90 c. 100

Question 17 : What shape is in the box ?

A. Circle B. Rectangle C. Square

Question 18 : What shape is it ?

A. Circle B. Rectangle C. Square

Question 19 : : Find the equal of : **25 + 5 =**

a. 20 + 5 b. 30 + 0 c. 10 + 10

Question 20 : Find the equal of : **12 + 8 =**

a. 12 +5 b. 10 + 10 c.13 + 4

LIVEWORKSHEETS