Anuban Lhanrak School
Grade 6 Quiz on Unit 2

Nickname:

Classify each polygon as simple or complex.

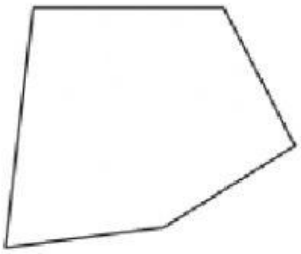

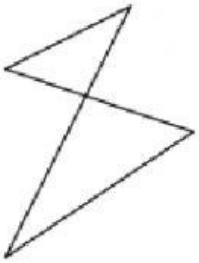

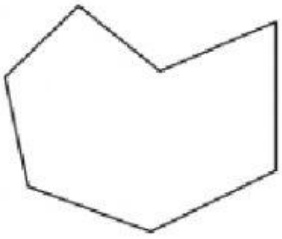

simple complex	simple complex	simple complex



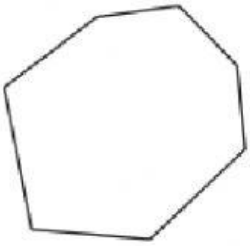

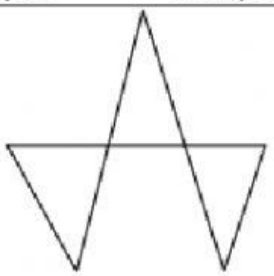

simple complex	simple complex	simple complex

Complete the table.

Name	Regular polygons	Sides	Each angle	Sum of interior angles
triangle	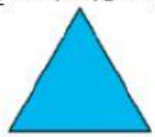		60°	180°
quadrilateral		4	90°	
hexagon	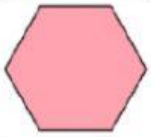			720°
octagon			135°	

LIVEWORKSHEETS

Find the **perimeter** of the following:

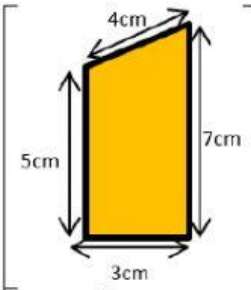		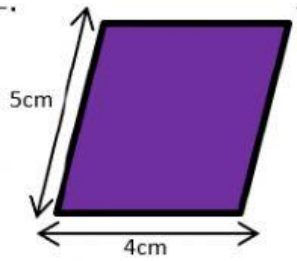	
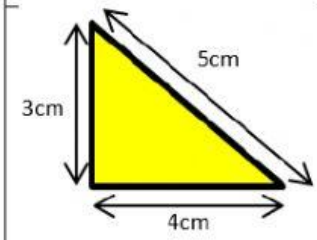		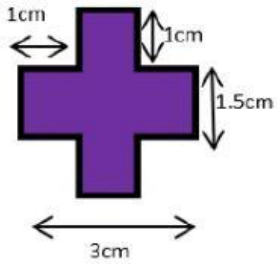	
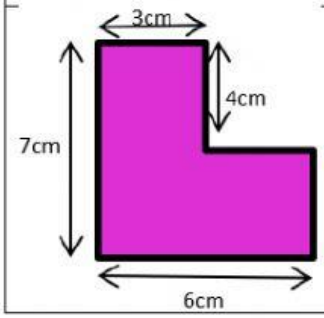			

Find the **area** of the following:

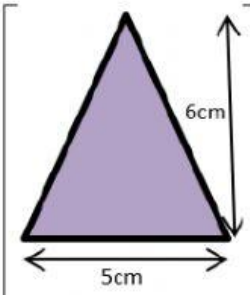	A(triangle) = $\frac{1}{2}$ x base x height
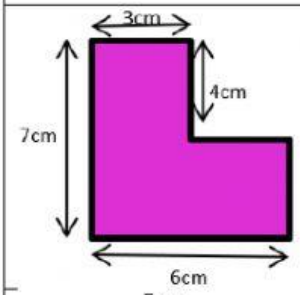	A = base x height
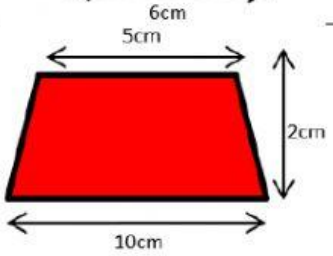	A(trapezium) = $\frac{1}{2}$ x (base1 + base2) x height

LIVEWORKSHEETS